Nama : .....

Kelas : .....

Menentukan Pecahan

Tentukan nilai pecahan dari gambar dibawah ini.
Tulis nilai pecahan pada kotak yang telah disediakan.

1.

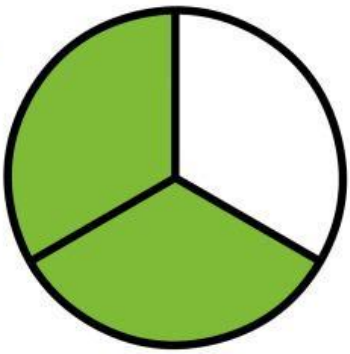

2.

3.



4.



5.

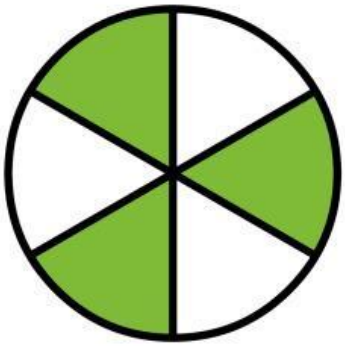

LIVEWORKSHEETS