Nama: .....

Kelas: .....

EVALUASI

MATEMATIKA

TEMA 2 SUBTEMA 4 PEMBELAJARAN 1

Petunjuk Pengerjaan

Buatlah garis yang menghubungkan antara nilai pecahan dengan gambar yang melambangkan nilai pecahannya! Jika sudah selesai, klik tombol Finish kemudian pilih bagian "share my answer to my teacher" dan masukkan email guru yang berada di halaman pertama.





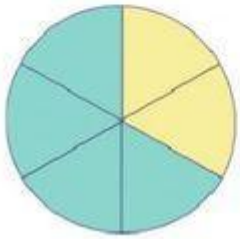

$\frac{1}{3}$

$\frac{2}{6}$

$\frac{1}{4}$

$\frac{1}{2}$

$\frac{1}{8}$

LIVEWORKSHEETS

Lembar Kerja

Pecahan

Tentukan nilai pecahan dari setiap bagian pizza

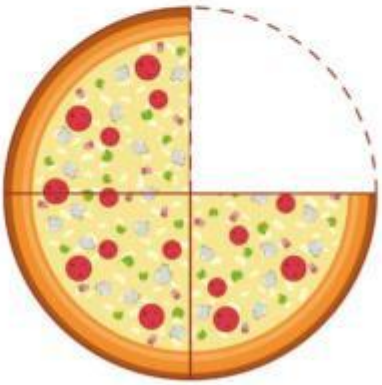

$\frac{3}{4}$

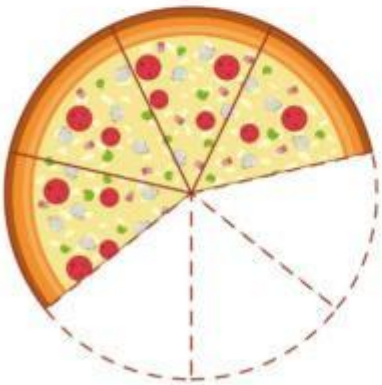

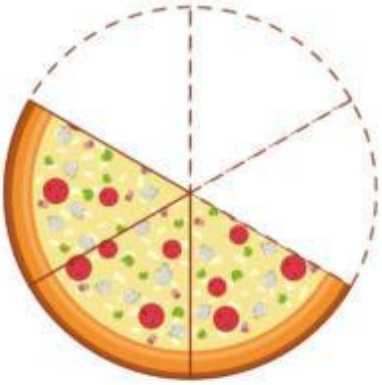

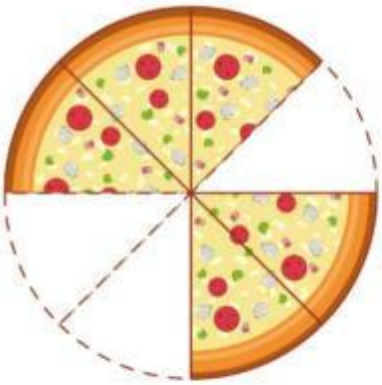

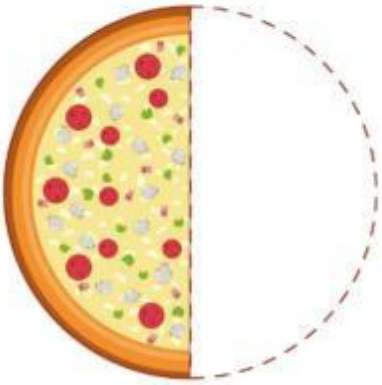

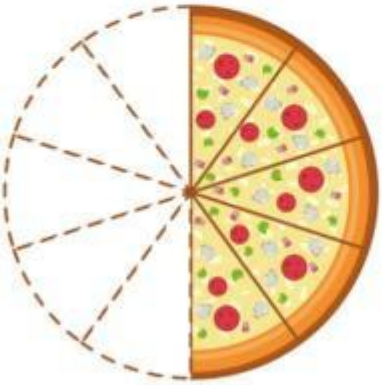

©2021 LembarKerja.Com
For more worksheets, please visit: https://lembarkerja.com/

LembarKerja.com
LIVEWORKSHEETS