Mathematics 5

Circumference of a Circle

Formula:

$C = 2\pi \times r$

$C = \pi \times d$

Use the formula to find the circumference of each circle.

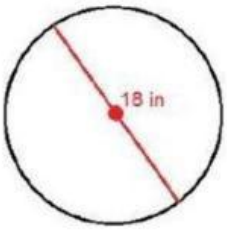

Ans: _____

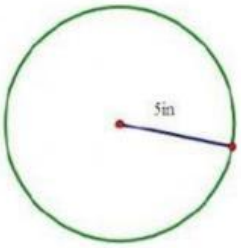

Ans: _____

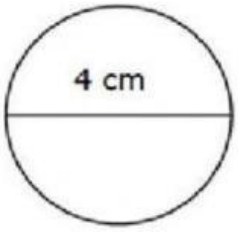

Ans: _____

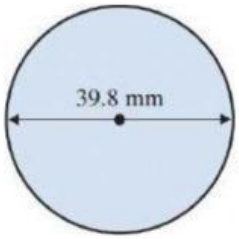

Ans: _____

The radius of circle is 2.5 cm long. How long is the diameter? Ans: _____

The diameter of circle is 15 cm long. How long is the radius? Ans: _____

LIVEWORKSHEETS