ZLOMKY

1) ZAPIŠ ZLOMKEM VYBARVENOU ČÁST:

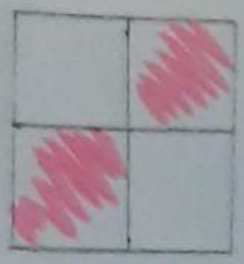





____ ____ ____

2) ZAPIŠ ZLOMKEM:

tři čtvrtiny ____ šest osmin ____ dvě třetiny ____

3) VYPOČÍTEJ ZLOMEK Z ČÍSLA:

$\frac{1}{7}$ z 21 = ____ $\frac{1}{4}$ z 240 = ____ $\frac{1}{9}$ z 54 = ____

$\frac{2}{9}$ z 81 = ____ $\frac{3}{5}$ z 50 = ____ $\frac{2}{3}$ z 15 = ____

4) VYPOČÍTEJ:

$\frac{16}{12} - \frac{12}{12} =$ ____ $\frac{29}{40} - \frac{20}{40} =$ ____ $\frac{57}{60} - \frac{33}{60} =$ ____

$\frac{6}{15} + \frac{3}{15} =$ ____ $\frac{42}{60} + \frac{11}{60} =$ ____ $\frac{27}{50} + \frac{14}{50} =$ ____

LIVEWORKSHEETS