Nome: _____

AVALIAÇÃO TRIÂNGULOS E ÂNGULOS

ARRASTE CADA TRIÂNGULO AO LUGAR CORRESPONDENTE:

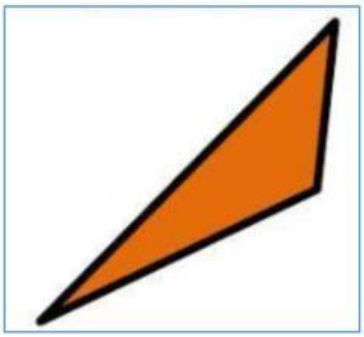
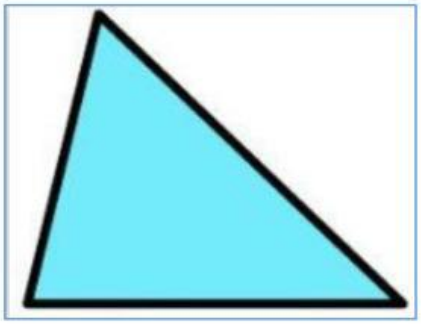
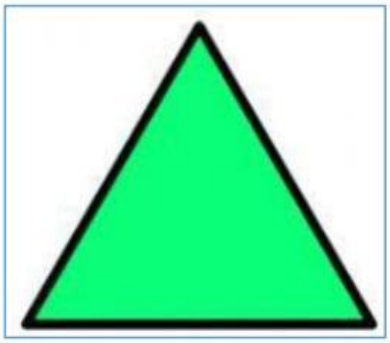
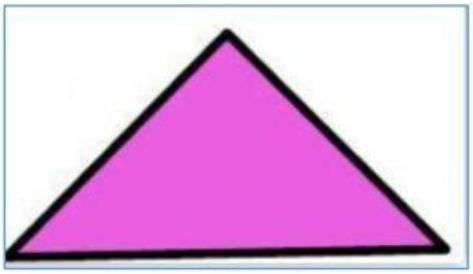



EQUILÁTERO TEM OS TRÊS LADOS IGUAIS	ISÓSCELES TEM DOIS LADOS IGUAIS E UM DIFERENTE	ESCALENO TEM OS TRÊS LADOS DIFERENTES

LIVEWORKSHEETS

RELACIONE ATRAVÉS DE LINHAS A INFORMAÇÃO CORRESPONDENTE À CLASSIFICAÇÃO DOS TRIÂNGULOS PELAS MEDIDAS DE SEUS ÂNGULOS:

TRIÂNGULO ACUTÂNGULO	**TEM UM ÂNGULO RETO**
TRIÂNGULO OBTUSÂNGULO	**TEM UM ÂNGULO OBTUSO**
TRIÂNGULO RETÂNGULO	**TEM UM ÂNGULO AGUDO**

ESCREVA O NOME CORRETO DE CADA TRIÂNGULO: EQUILÁTERO, ISOSCELES E ESCALENO



ESCOLHA A OPÇÃO CORRETA:

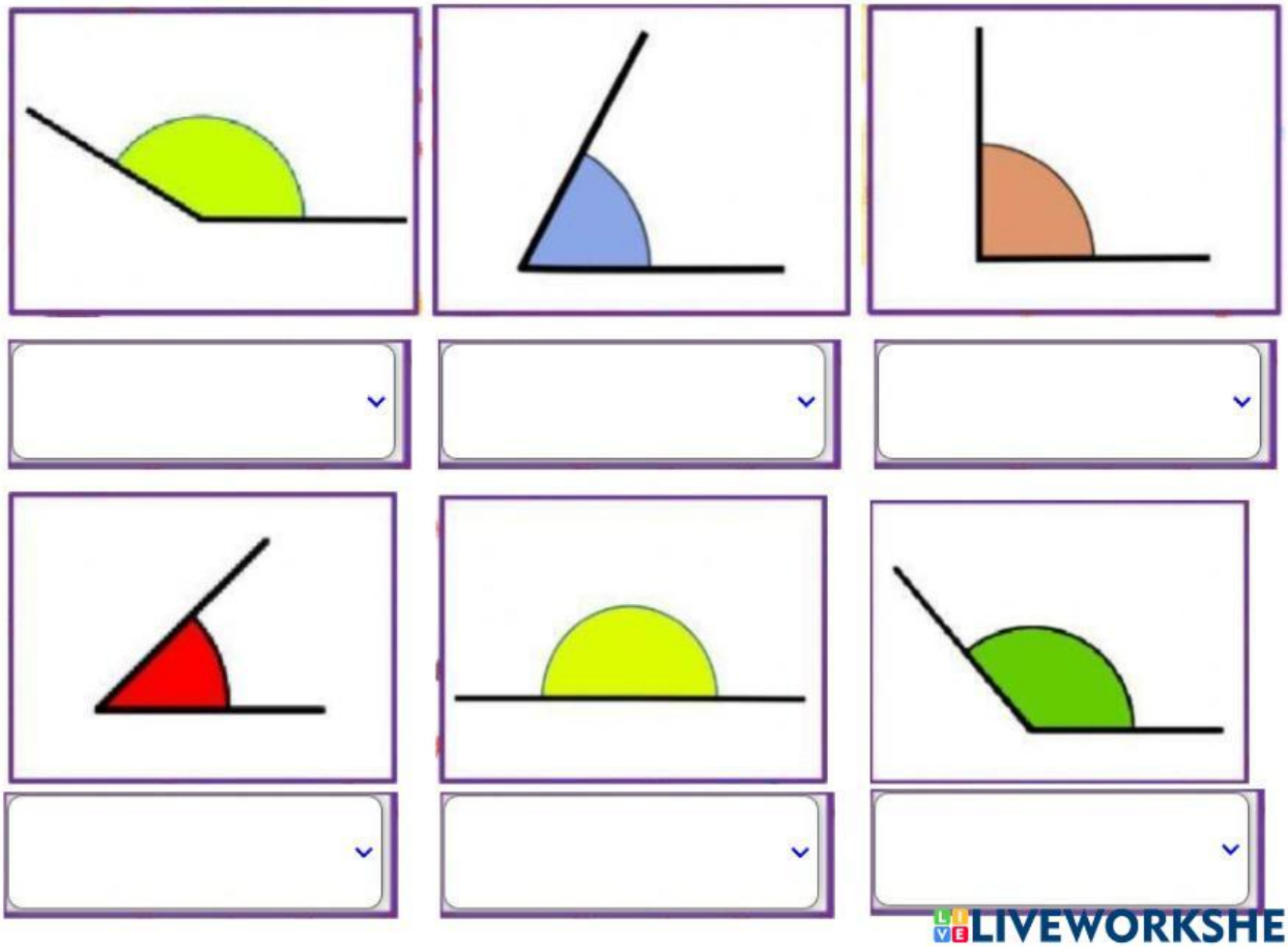

LIVEWORKSHEETS