Knowledge Oasis Private School

Grade – 6

Subject – Math

مدرسة واحة المعرفة الخاصة
KNOWLEDGE OASIS PRIVATE SCHOOL

Angles

1. Fill in the blanks

a. An angle of measure 50 ° is an _____

b. An angle of measure 180° is an _____

c. An angle of measure 130 ° is an _____

d. An angle of measure 90 ° is an _____

2) Drag the picture in its correct place.

Null Angle	Acute Angle	Right Angle	Obtuse Angle	Straight Angle

LIVEWORKSHEETS

3) Order the steps of drawing an angle of measure 50°.

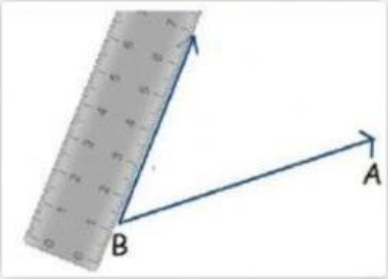

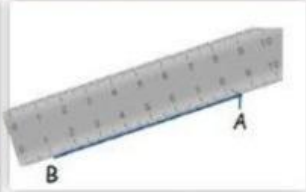

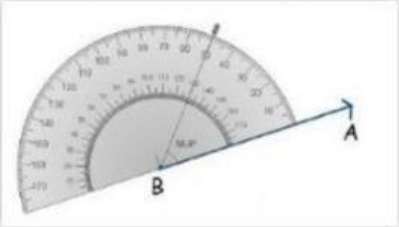

Step 1	Step 2
Step 3	**Step 4**

LIVEWORKSHEETS

4. What is the measurement of x in the following picture

(a) 65^0

(b) 90^0

(c) 10^0

(d) 180^0

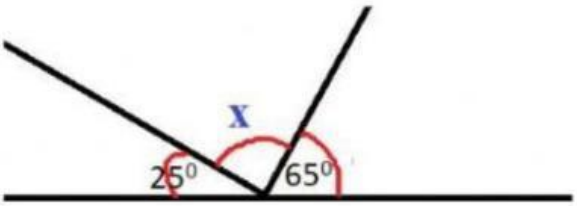

5. How many right angles are there in the letter A?

(a) 2

(b) 5

(c) 3

(d) 0

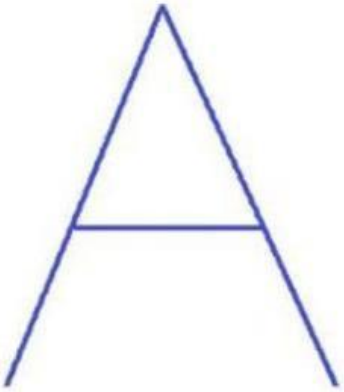

LIVEWORKSHEETS

6. Drag lines to match the arrows

Right Angle

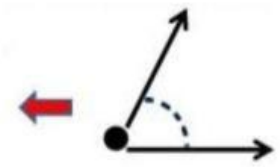

Obtuse Angle

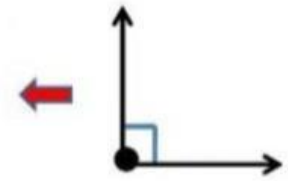

Acute Angle

Reflex angle

LIVEWORKSHEETS