LKPD
MATEMATIKA

Name:_____

LIVEWORKSHEETS

Nama : Kelas :

Jumlah Bunga

Hitunglah jumlah gambar bunga berikut !







LIVEWORKSHEETS