Kurikulum Merdeka

# LKPD

## KEKONGRUENAN DAN KESEBANGUNAN

Nama :

No Absen :

LIVEWORKSHEETS

# KEGIATAN 1

**Carilah pasangan bangun yang kongruen dan letakkan gambar dikotak yang disediakan**







LIVEWORKSHEETS

# KEGIATAN 2

**Hubungkan dengan garis pasangan bangun datar dibawah ini yang kongruen**

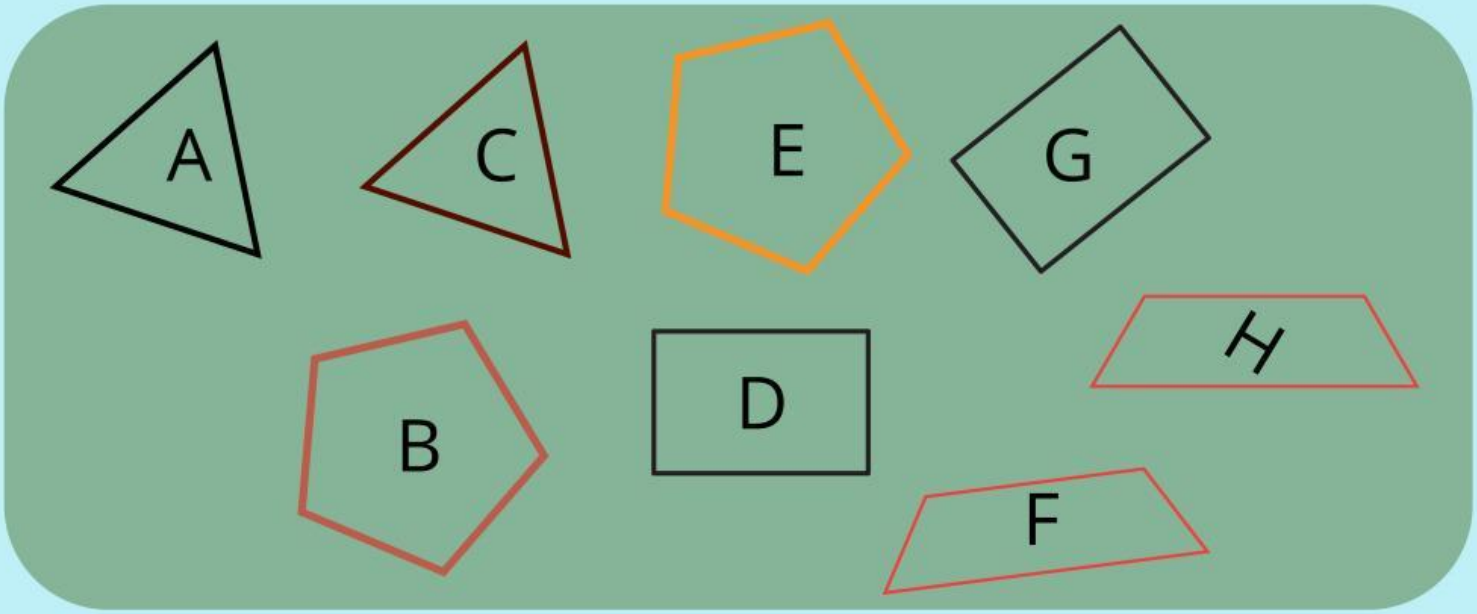


LIVEWORKSHEETS

# KEGIATAN 3

**Trapesium ABCD kongruen dengan trapesium EFGH. Tentukan pasangan sudut yang bersesuaian!**

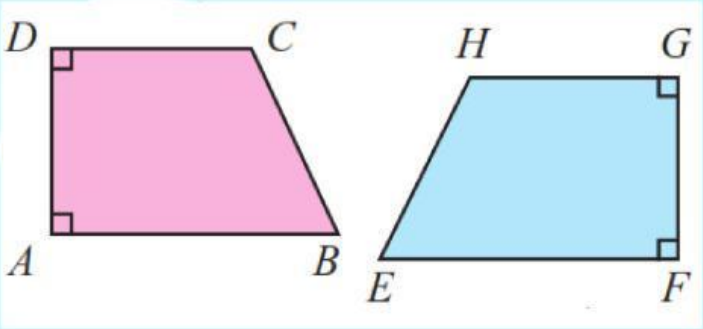


**Sudut A = Sudut.....**

**Sudut B = Sudut.....**

**Sudut C = Sudut.....**

**Sudut D = Sudut.....**

**Perhatikan gambar dibawah!**
**Trapesium ABCD kongruen dengan trapesium PQRS. Tentukan panjang AD, DC, QR, dan, QP!**

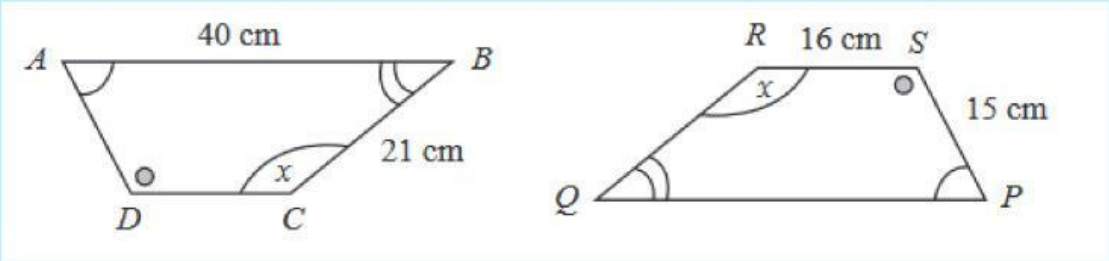


Panjang AD = Panjang ... = ... cm

Panjang QR = Panjang ... = ... cm

Panjang DC = Panjang ... = ... cm

Panjang QP = Panjang ... = ... cm

LIVEWORKSHEETS