5 Multiplication Tables of 1, 2 and 3

Let's Learn!

Multiplying 1: Skip-counting

1 There is 1 coin in each bag.

$1 \times 1 = 1$

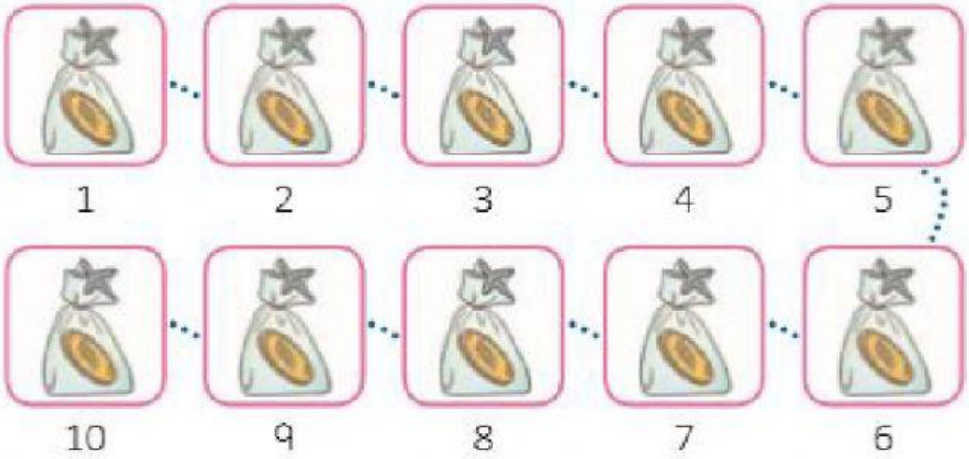

How many coins are there in 10 bags?

1 2 3 4 5 6 7 8 9 10

$10 \times 1 = 10$

There are 10 coins.

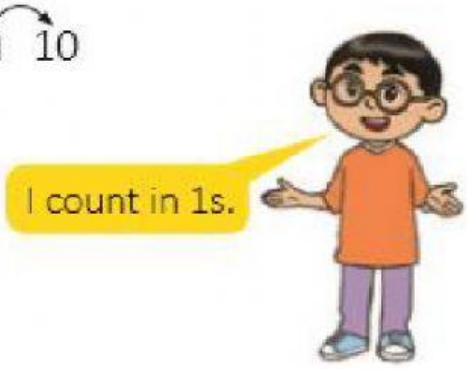

LIVEWORKSHEETS

2 Yati has 4 cups.
She puts 1 scoop of ice cream in each cup.
How many scoops of ice cream does Yati have altogether?

$\square \times 1 = \square$



Yati has ☐ scoops of ice cream altogether.

Let's Practise
WB 2A, p 111
Practice 1

LIVEWORKSHEETS

Let's Learn!

Multiplying 1: Using Dot Paper

1

Each bag has 1 sandwich.
How many sandwiches will 3 bags have altogether?

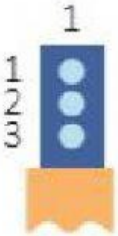

$3 \times 1 = 3$

3 bags will have 3 sandwiches altogether.

LIVEWORKSHEETS

2 Each girl has a bag.
How many bags are there altogether?



☐ × 1 = ☐

There are ☐ bags altogether.

3 Complete the table.

Multiplication Table of 1

1	×	1	=	1
2	×	1	=	2
3	×	1	=	3
4	×	1	=	4
5	×	1	=	5
6	×	1	=	6
7	×	1	=	☐
8	×	1	=	8
9	×	1	=	☐
10	×	1	=	10

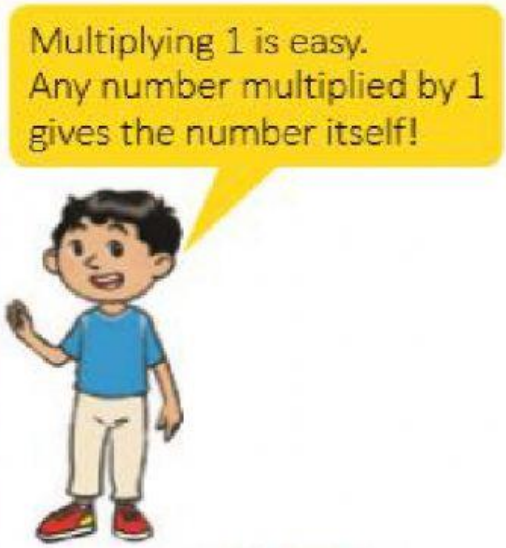

Let's Practise
WB 2A, p 112
Practice 2

LIVEWORKSHEETS