Mathematics

End of Week 6 Homework

1. Solve:
   4 - 2 $\frac{1}{2}$ =

2. What is 2/5 of 65 mangoes?
   _____ mangoes

3. Arrange from smallest to biggest.

$$\frac{3}{5} \qquad \frac{9}{20} \qquad \frac{3}{4} \qquad \frac{1}{2}$$

_____

4. Write 60, 702 in words.

_____

5. Calculate the missing angles

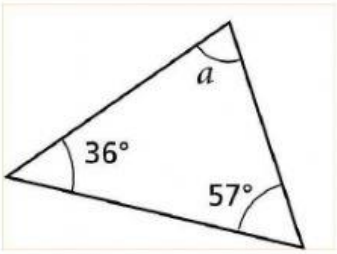

a = _____

LIVEWORKSHEETS

6. Name each triangle below.

isosceles	right-angle	equilateral	scalene

a. 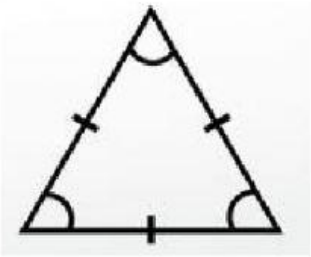 _____triangle

b. 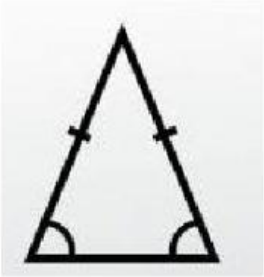 _____ triangle

c. 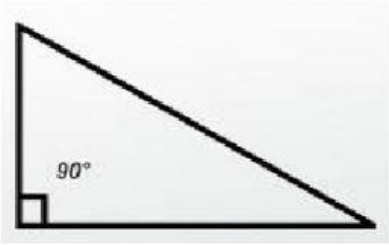

_____ triangle

LIVEWORKSHEETS

d. 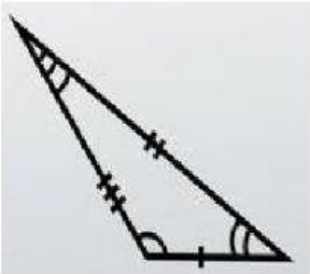 _____triangle

7. Complete:
   a. 734= 6 hundreds + _____tens + 4 ones
   b. 217 = 2 hundreds + _____ ones
   c. 3,765= 3 thousands + _____ hundreds + 16 tens + 5 ones

8. Round 364 to the nearest ten.

   _____

LIVEWORKSHEETS