ÀREES I PERÍMETRES

Troba l'àrea i el perímetre de les següents figures.

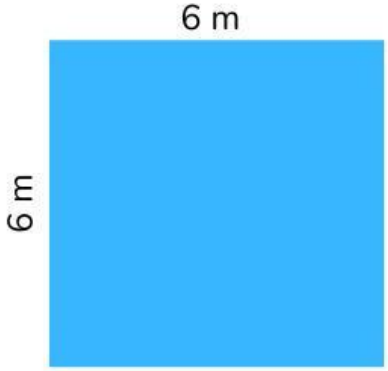

Perímetre = _____ m

Àrea = _____ m²

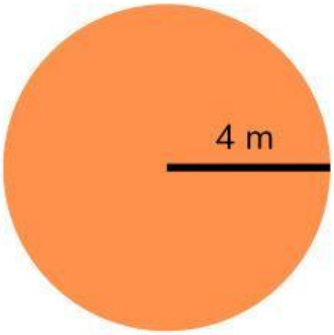

Perímetre = _____ m

Àrea = _____ m²

Perímetre = _____ m

Àrea = _____ m²

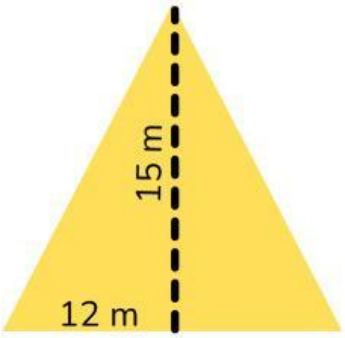

Perímetre = _____ m

Àrea = _____ m²

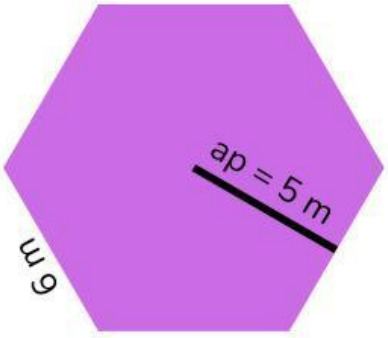

Perímetre = _____ m

Àrea = _____ m²

Perímetre = _____ m

Àrea = _____ m²



Perímetre = _____ m

Àrea = _____ m²

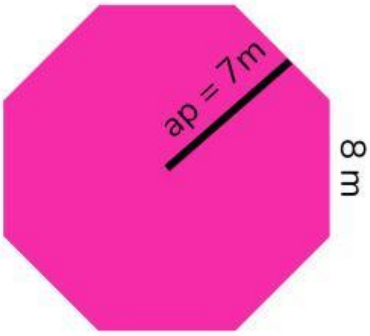

Perímetre = _____ m

Àrea = _____ m²

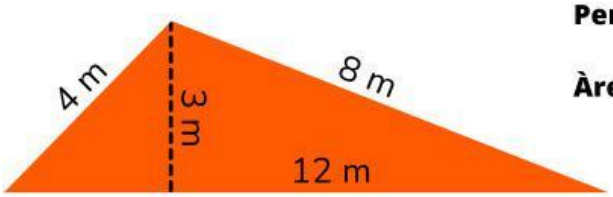

Perímetre = _____ m

Àrea = _____ m²

LIVEWORKSHEETS