INSPIRED TOTS EARLY LEARNING CENTRE SECOND TERM EXAMINATION
2023/2024 SESSION.

Name: _____ 1st Grade Date: _____

Instruction: study the example below on 2-times table and fill in the boxes with the correct answers.

2 × 1 = 2	2 × 2 = 4	2 × 3 = 6

1) 2 × 5 = ☐

2) 2 × 9 = ☐

3) 2 × 6 = ☐

4) 2 × 4 = ☐

5) 2 × 3 = ☐

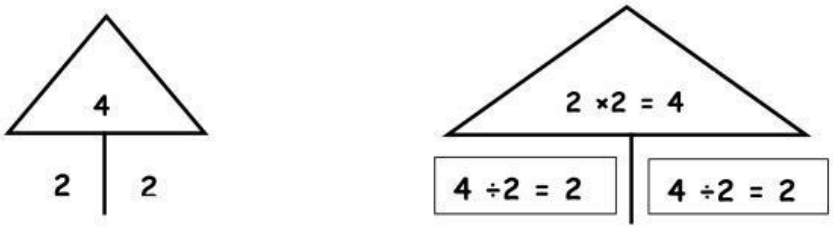

Instruction: Use your knowledge of the 2-times table to find the missing numbers in the diagrams below.

6) ☐ → 2 | 8

7) ☐ → 2 | 4

8) ☐ → 2 | 7

9) ☐ → 2 | 9

10) ☐ → 2 | 6

11) ☐ → 2 | 5

12) ☐ → 2 | 3

13) ☐ → 2 | 1

LIVEWORKSHEETS

INSPIRED TOTS EARLY LEARNING CENTRE SECOND TERM EXAMINATION
2023/2024 SESSION.

Name: _____ 1st Grade Date: _____

Instruction: Study the examples below on the 3-times table. Write the correct answers in the boxes provided.

3 × 1 =3	3 × 2 = 6	3 × 3 = 9

14) 3 × 4 = ☐

15) 3 × 5 = ☐

16) 3 × 6 = ☐

17) 3 × 7 = ☐

18) 3 × 8 = ☐

19) 3 × 10 = ☐

Sample:

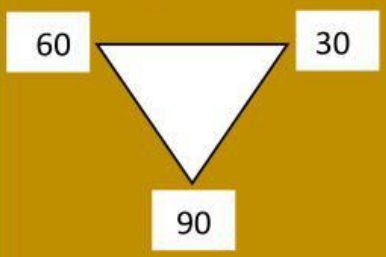

20)

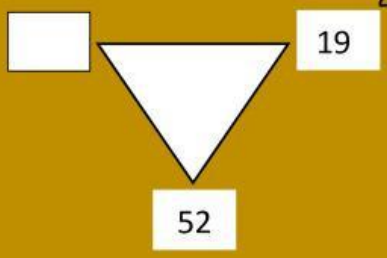

21)

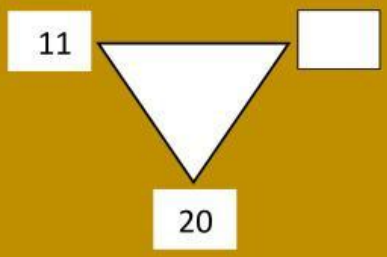

22)

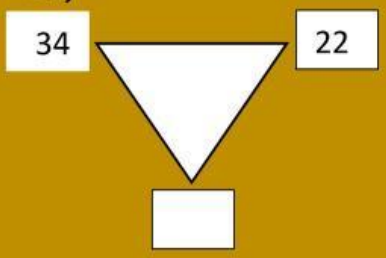

Sample:

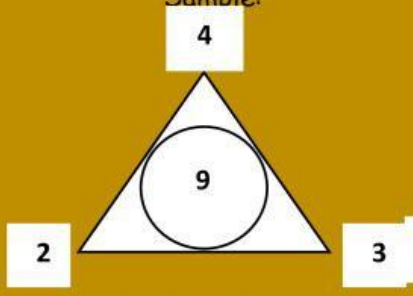

23)

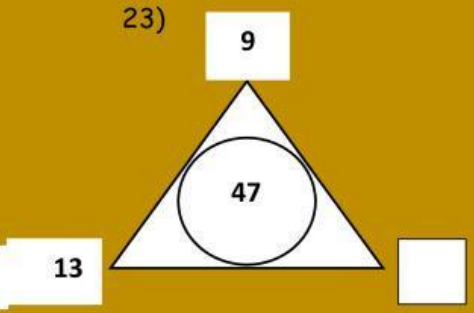

24)

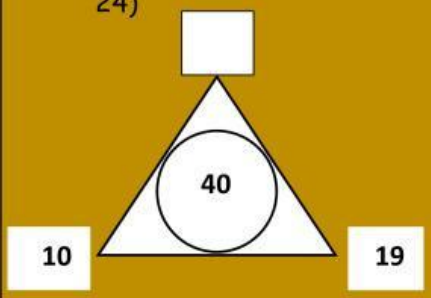

25)

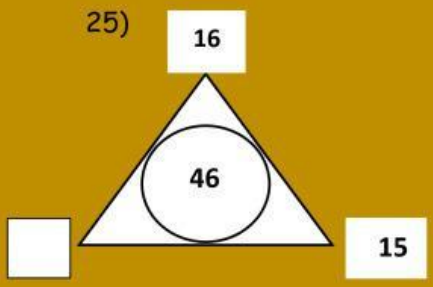

26)

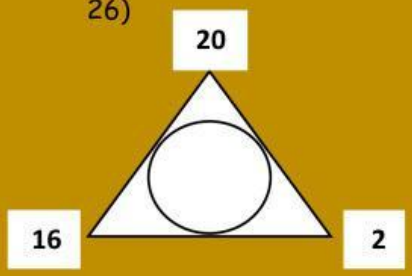

LIVEWORKSHEETS