LA HORA

¿Cuánto tiempo pasa entre los 2 relojes?

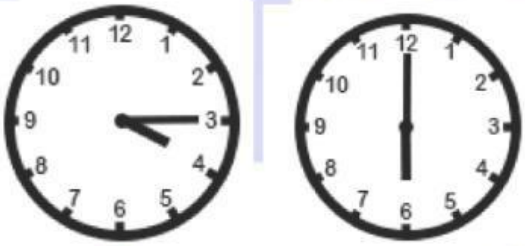

h min



h min



h min



h min



h min



h min

LIVEWORKSHEETS