Aula Especializada - E.M.O.V.B – 5º ANO - Prof. Odair – 22 a 26/02/2021

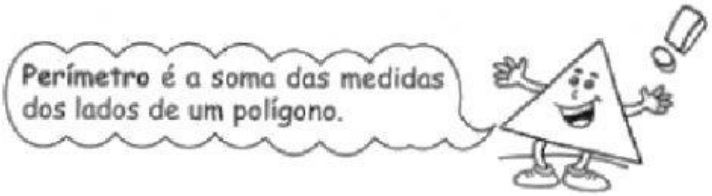

1 – Calcule o perímetro e marque a resposta certa:

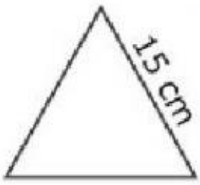

P = ...



P = ...

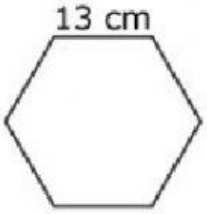

P = ...

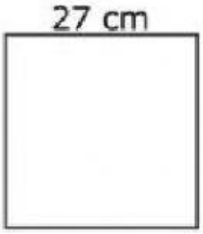

P = ...

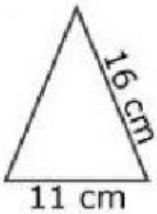

P = ...

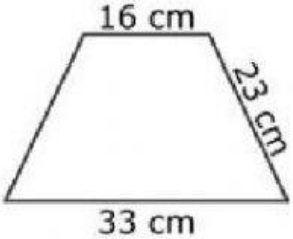

P = ...

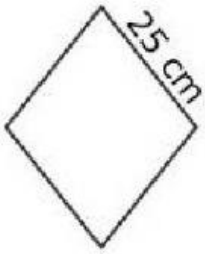

P = ...

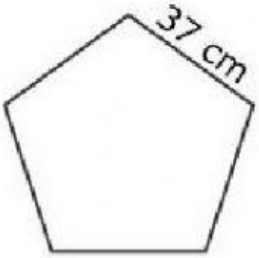

P = ...

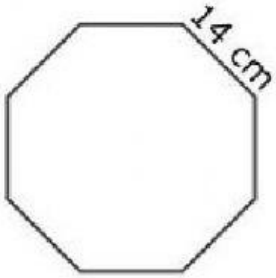

P = ...

LIVEWORKSHEETS

2 – Calcule e depois ligue cada personagem ao seu nome:

Hoje completo 5 trimestres.
Quantos meses tenho?

___ × ___ = ___ meses.

Tem 300 anos.
Chama-se Dino.

Hoje completo seis décadas.
Quantos anos tenho?

___ × ___ = ___ anos.

Tem 48 meses.
Chama-se Dulce.

Hoje completo 8 semestres.
Quantos meses tenho?

___ × ___ = ___ meses.

Tem 600 meses.
Chama-se Mariana.

Hoje completo 50 anos.
Quantos meses tenho?

___ × ___ = ___ meses.

Tem 60 anos.
Chama-se Valentino.

Hoje completo 3 séculos.
Quantos anos tenho?

___ × ___ = ___ anos.

Tem 15 meses.
Chama-se Pimpão.

https://atividadespedagogicasuzano.com.br/5-ano-perimetro-poligono-em-pdf/
https://br.pinterest.com/pin/252201647869255879/?d=t&mt=signup

LIVEWORKSHEETS