Identify Key Features of Quadratic Equations Interactive Worksheet

$y = (x+2)(x-4)$	$y = (x-2)^2 - 4$	$y = \frac{1}{2}x^2 + x - 4$	$y = -(x+2)^2 + 4$

Match the graphs to the correct equations

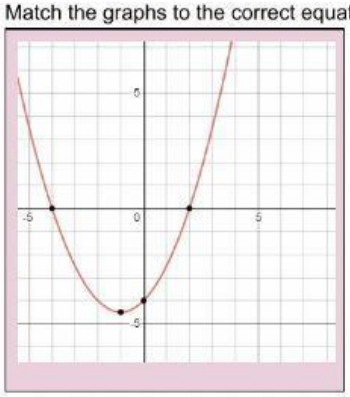

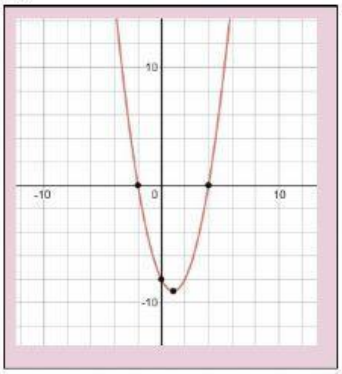

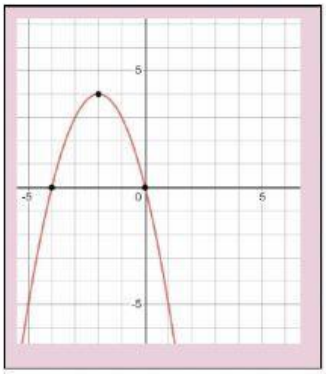

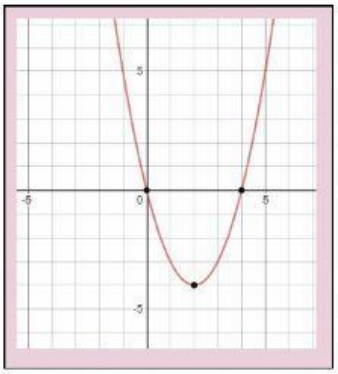

Name the form:	Name the form:	Name the form:	Name the form:
x-intercept(s):	x-intercept(s):	x-intercept(s):	x-intercept(s):
y-intercept(s):	y-intercept(s):	y-intercept(s):	y-intercept(s):
vertex:	vertex:	vertex:	vertex:
Axis of symmetry:	Axis of symmetry:	Axis of symmetry:	Axis of symmetry:

LIVEWORKSHEETS