FAMILY AND FRIENDS

I . Circle the odd-one-out. (Khoanh tròn từ mang nghĩa khác loại).

1. A. socks	B. shorts	C . kitchen	D. coat
2. A. sheep	B. dress	C. T-shirt	D. pants
3. A. fish	B. shoes	C. lion	D. goat
4. A. living room	B. hat	C. bedroom	D. bathroom
5. A. house	B. apartment	C. chair	D. dining room

II. Count and write. (Đếm và viết) (1 điểm)

1. seven + eight =_____

2. eighteen – six =_____

3. Seventeen + three =_____

4. Eight + Eight = _____

5. Three + ten =_____

6. Twenty – five =_____

7. Eight + Ten =_____

8. Twelve – six =_____

9. Eleven + seven = _____

10. Fourteen – Nine =_____

LIVEWORKSHEETS

III. Write the word. (Viết từ.) (1 điểm)

1._ _ __ _ _ _ _ _ _ (c l e r i c) hình tròn

2._ _ _ _ _ _ _ _ _ _ (o a c t) áo khoác

3._ _ _ _ __ _ _ _ _ _ (g p i) con heo

4._ _ _ _ _ _ _ _ _ _ _ _ (t g r e i) con cọp

5._ _ __ _ _ _ _ _ _ (b r z e a) con ngựa vằn

6._ _ _ _ _ _ _ _ _ _ (r f e f a g i) con hươu cao cổ

7._ _ _ _ __ _ _ _ _ _ (o s e u h) căn nhà

8._ _ _ _ _ _ _ _ _ _ _ _ (l o n i) con sư tử

I. Choose the correct answer

1. Where _____ the bag? - It's on the table.

A. is B. are

2. _____ these her shoes? - No, they aren't

A. Is B. Are

3. My brother _____ happy

A. is B. are

4. How _____ you? - I'm very well. Thanks

A. is B. are

5. They _____ on the bed.

A. is B. are

LIVEWORKSHEETS

MATHEMATICS

Even numbers can be paired up.

3+3



☐ **Odd** ☑ **Even**

Odd numbers have 1 number leftover from the pairs.

8+1

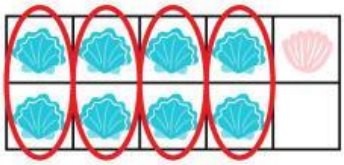

☑ **Odd** ☐ **Even**

Is the sum even or odd? Check the correct answer.

5+3

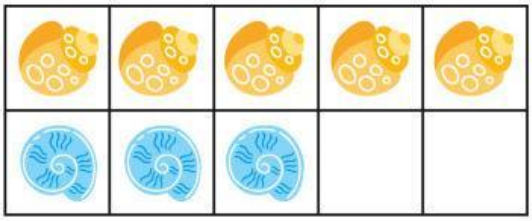

☐ **Odd** ☐ **Even**

6+1



☐ **Odd** ☐ **Even**

12+2

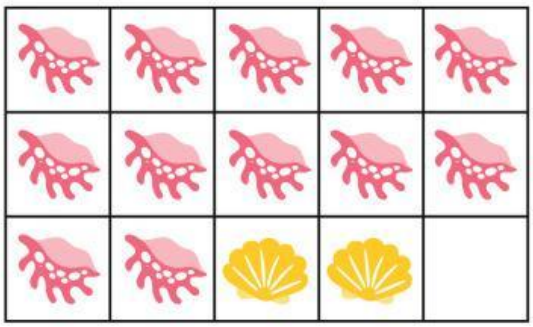

☐ **Odd** ☐ **Even**

10+3

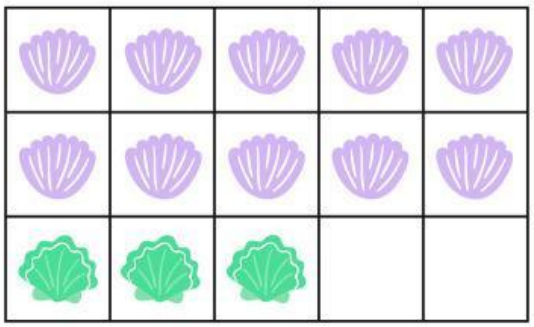

☐ **Odd** ☐ **Even**

LIVEWORKSHEETS

Count the objects and tell whether there is an odd or even number of objects



How many sheep? _____

Odd or even? _____

How many bananas? _____

Odd or even? _____

How many babys? _____

Odd or even? _____



How many cats? _____

Odd or even? _____

How many frogs? _____

Odd or even? _____

LIVEWORKSHEETS

1. 114 birds were sitting in a tree. 21 more birds flew up to the tree. How many birds were there altogether in the tree?

2. 29 birds were sitting in a tree. Some more fly up to the tree. Then there were 142 birds in the tree. How many more flew up to the tree?

3. Beth has 74 crayons. She gives 25 of them away to Jen. How many crayons does Beth have left?

LIVEWORKSHEETS

SCIENCE

I. Choose the correct answer:

1. To stay safe, you should _____ when using electricity.

A. eat

B. take care

C. wash your hands

2. Mains electricity can be _____

A. dangerous

B. pink

C. happy

3. Never use a _____ wire

A. damaged

B. blue

C. long

LIVEWORKSHEETS

II. True or false:

1. Never put anything other than a plug into a wall socket.

A. True

B. False

2. You should use electricity near water.

A. True

B. False

LIVEWORKSHEETS