LKPD

LINGKARARAN



Kerjakan soal di bawah ini!

1. Perhatikan gambar berikut !

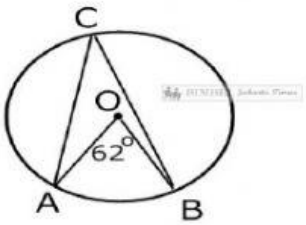

Besar < ACB adalah ...

A. 27^0

B. 31^0

C. 118^0

D. 124^0

LIVEWORKSHEETS

2. Perhatikan gambar berikut !

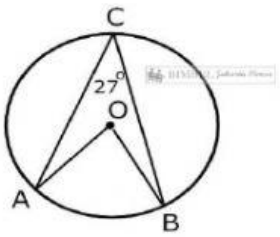

Besar < AOB adalahh ...

A. 54^0

B. 63^0

C. 117^0

D. 153^0

3. Perhatikan gambar berikut

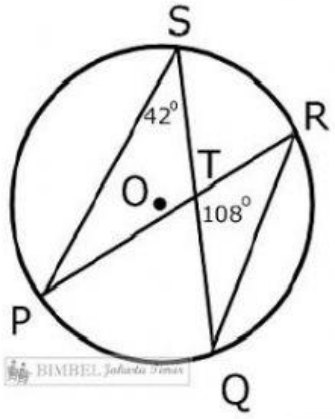

Besar < SQR adalah

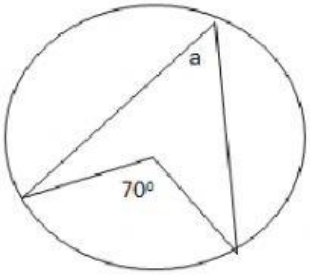

Sudut a dinamakan

LIVEWORKSHEETS

4. Buatlah garis ke jawaban yang benar

Suatu kue berbentuk lingkaran padat dengan jari-jari 14 cm. Kue tersebut dibagi 6 bagian berbentuk juring yang sama bentuk. Ukuran sudut pusat masing-masing potongan adalah ...

78^0

Perhatikan gambar di bawah ini!

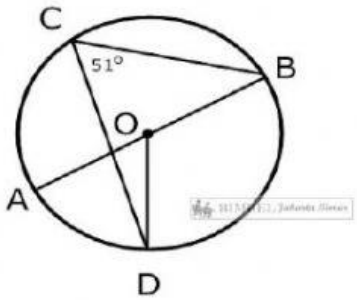

Jika AB adalah diameter lingkaran, maka besar <AOD adalah... ^{0}

50^0

Perhatikan gambar di bawah ini!

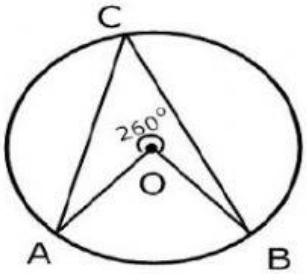

Jika besara sudut reflek <AOB =260^0, maka besar < ACB....

60^0

LIVEWORKSHEETS

5. Tariklah jawaban yang sesuai dengan gambar besar sudut pusat <AOB

	Besar <AOB	Pilihan Jawaban
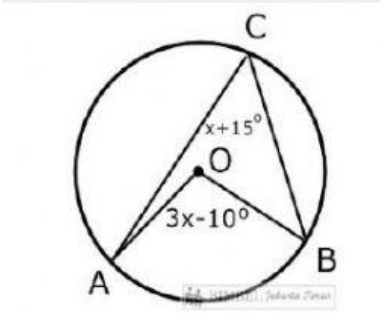		106^0
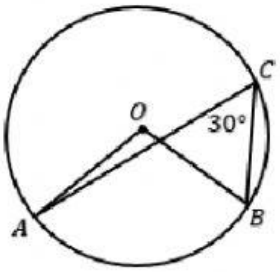		110^0
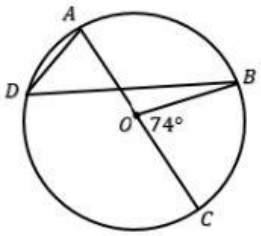		60^0

LIVEWORKSHEETS