TEOREMA INALTIMII

Se da triunghiul ABC, unde AD este inaltimea triunghiului dusa din varful A pe ipotenuza BC.

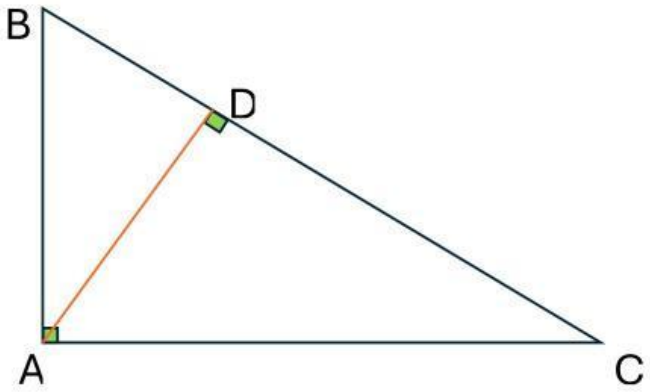

Alege varianta corecta:

TEOREMA CATETEI

Se da triunghiul ABC, unde AD este inaltimea triunghiului dusa din varful A pe ipotenuza BC.

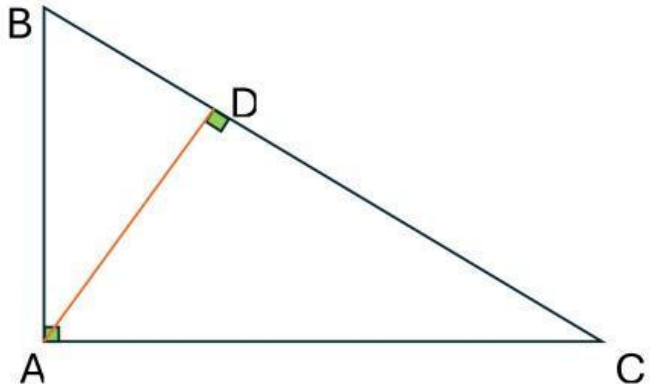

Alege varianta corecta pentru cateta AB:

Alege varianta corecta pentru cateta AC:

LIVEWORKSHEETS

TEOREMA LUI PITAGORA

Se da triunghiul ABC, unde AB si BC sunt catete, iar BC este ipotenuza.

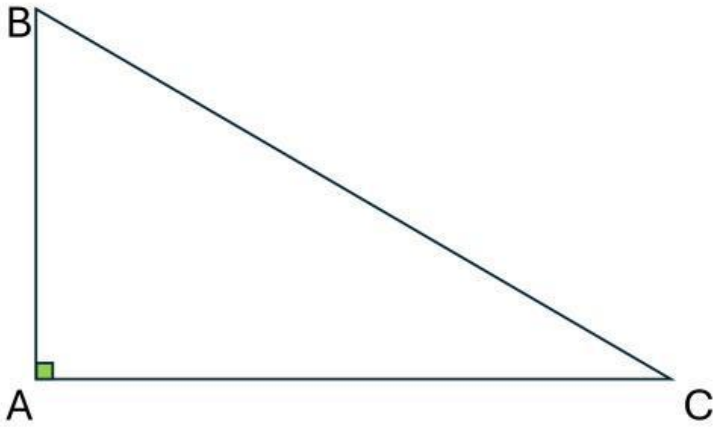

Alege varianta corecta :

TEOREMA MEDIANEI

Se da triunghiul ABC cu AD mediana dusa pe ipotenuza BC.

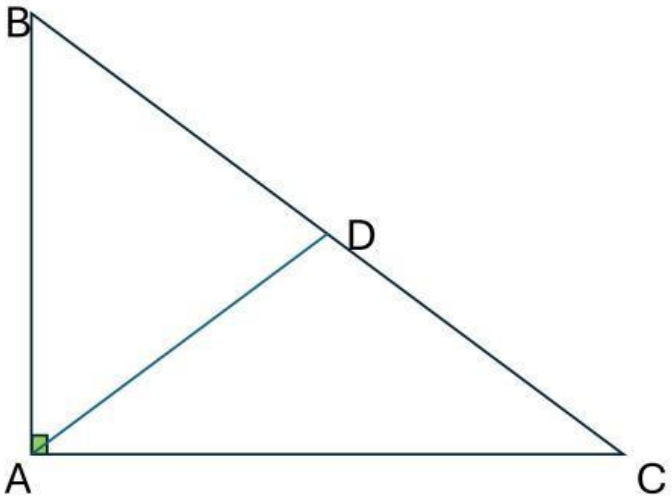

Alege varianta corecta:

Alege varianta corecta pentru relatiile de congruenta determinate de mediana in triunghi:

LIVEWORKSHEETS

LIVEWORKSHEETS