Effect of geosphere – Work sheet
Level – 1(Basic)

Match the landforms:

1. **Mountains**

2. **Volcanoes**

3. **Forest Soil**

4. **Desert soil**

5. **Grass land soil**

LIVEWORKSHEETS

2. Label <u>magma and lava, ash cloud</u> in the picture.

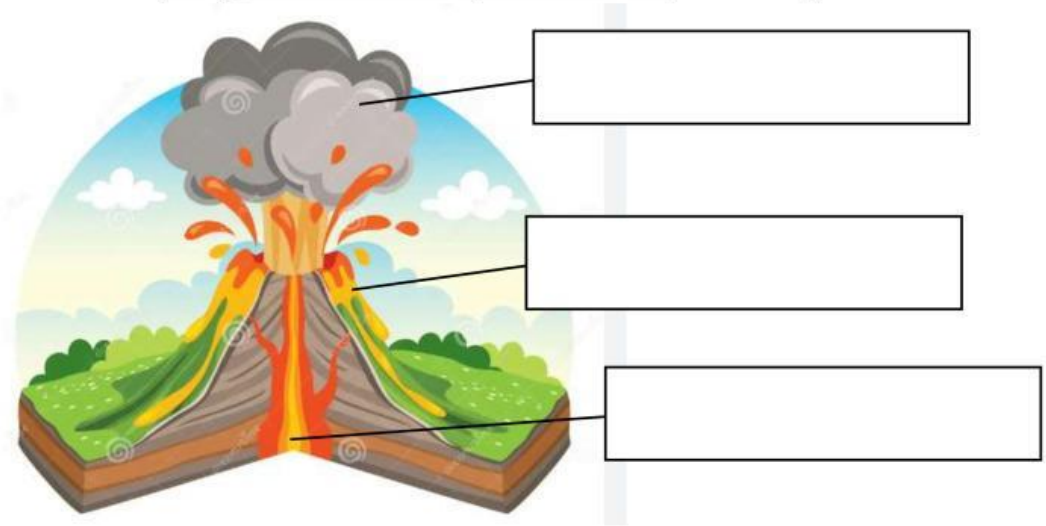

<u>Topic: Effects of the hydrosphere</u>

Match the following systems with its name:

A. Hydrosphere	 **All land or solid and molten rocks**
B. Geosphere	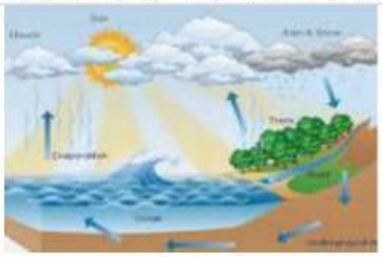 **Entire water (solid, liquid and gas) on earth**
C. Atmosphere	**Entire gas on Earth.**

LIVEWORKSHEETS

3. Name the landforms in the diagram.

[delta, flood plain, alluvial fan]

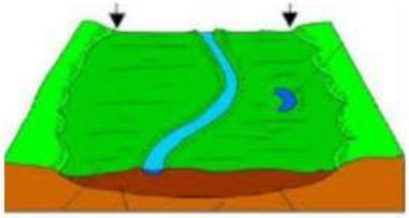

....

4. use the words in the box to label the diagram below.

Weathering	**erosion**	**deposition**

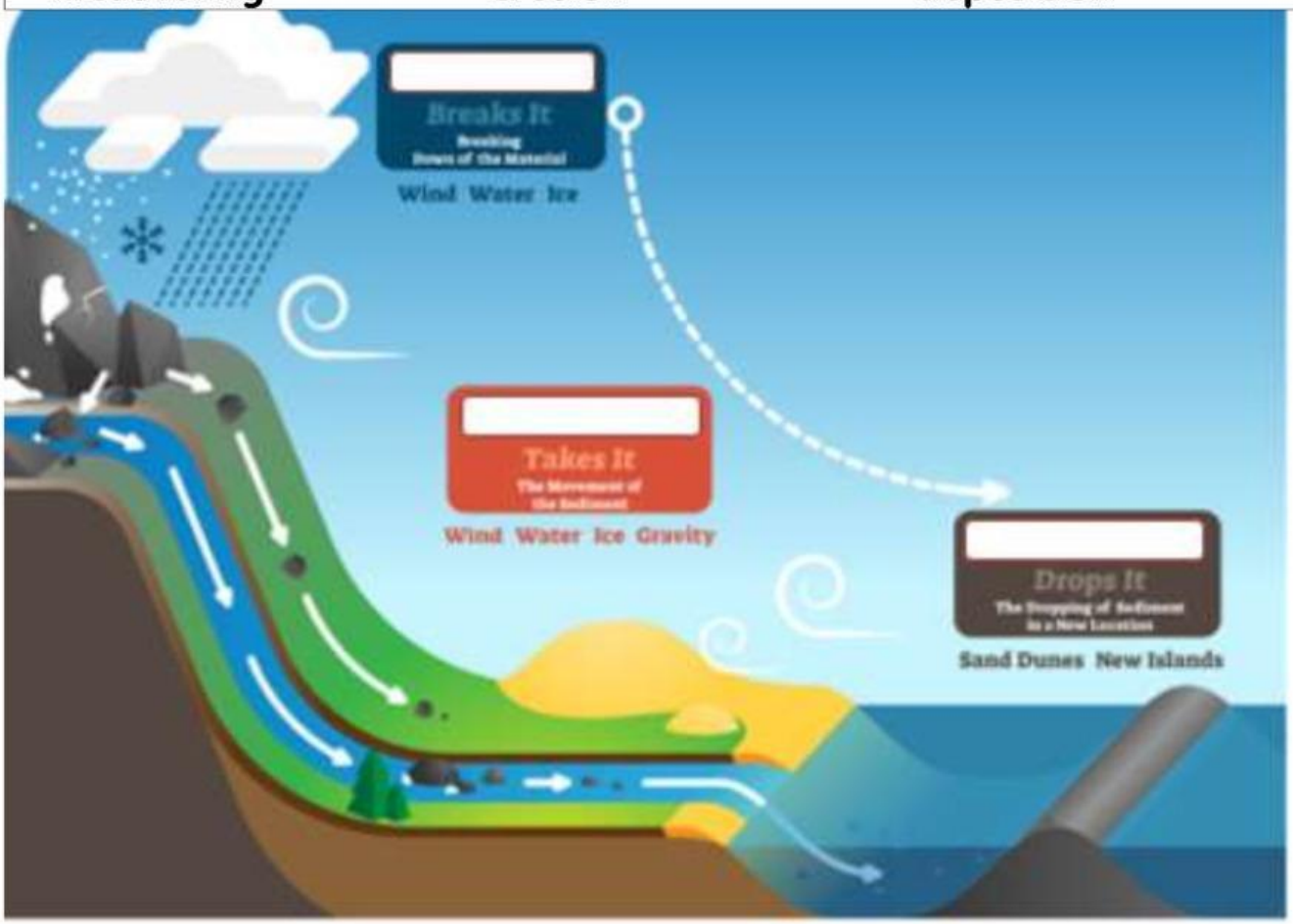

LIVEWORKSHEETS

6. Write where does the below phenomenon occurs?
(on shore/ above ocean)

a. **Hurricane: .....**

b. **Storm surges: .....**

8. Name types of mountains.

[volcanic mountain , folded mountain, fault-block mountains]

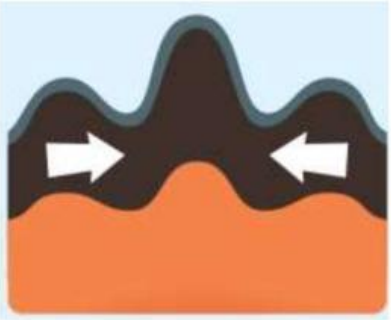

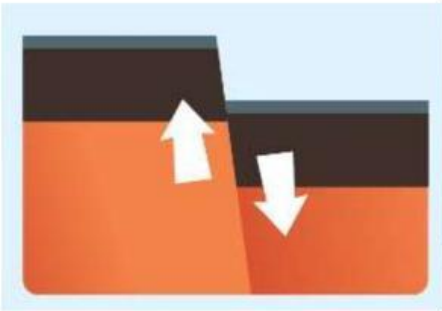

LIVEWORKSHEETS