Name_____

Date_____

Mathematics

Points, Line, Line Segment, Ray and Plane

Write each as points, line, line segment, ray or plane.

1.

_____

2.

_____

3.

_____

4. 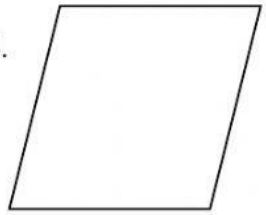

_____

5.

_____

Name the figures.

6.

_____

7. 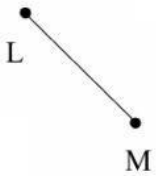

_____

8.

_____

9. 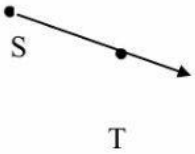

_____

10. 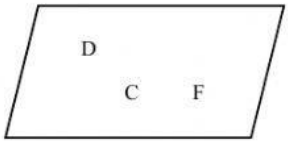

_____

LIVEWORKSHEETS