Name: _____ Grade: 8A1

Warm up:

Find each missing length

1)

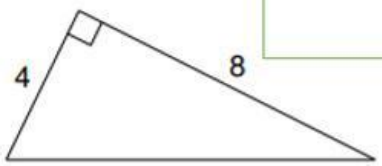

2)

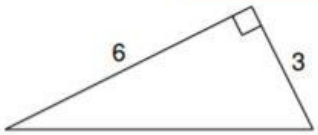

3)

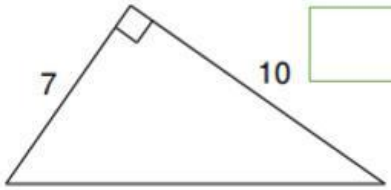

4)

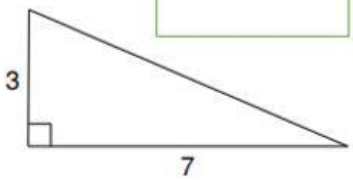

Answers:

6.7

8.9

7.6

12.2

LIVEWORKSHEETS