Lesson plan 64: Worksheet

1. A circle graph is used for

   A. displaying continuous data only

   B. displaying data that are always in percentages

   C. displaying discrete data only

   D. displaying both discrete and continuous data

2. The circle graph below shows area occupied in percent by different vegetable in a kitchen garden.
   The central angle for beans will be

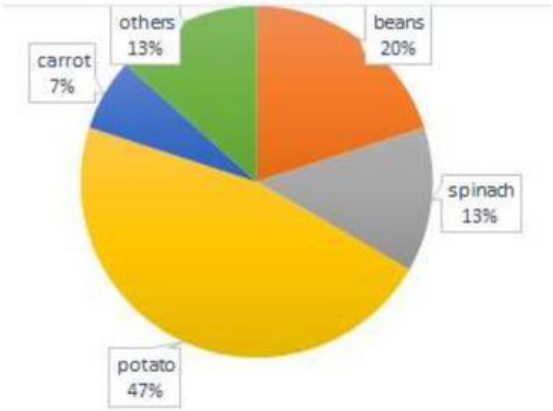

   A. 20º

   B. 50º

   C. 72º

   D. 120º

3. What conclusion can you draw from above graph

   A. Spinach occupies the least area

   B. The garden have 5 varieties of vegetables

   C. The area dedicated to potato is the maximum

   D. Beans and spinach occupies half of the area of garden

LIVEWORKSHEETS

4. The table below shows fruits procured in a school function

Fruits procurement in a school program (Kg)	
Mandarin	5
Apple	15
Grapes	2
Apricot	1

Which chart below represent above data

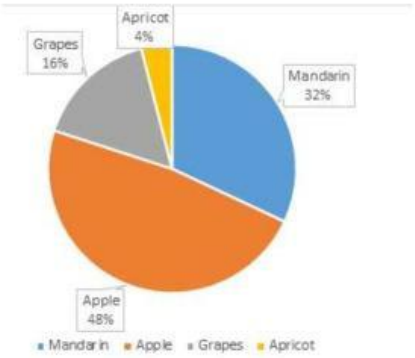

A.

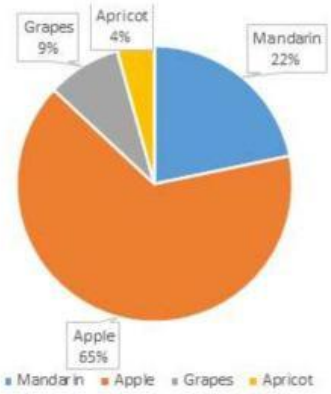

B

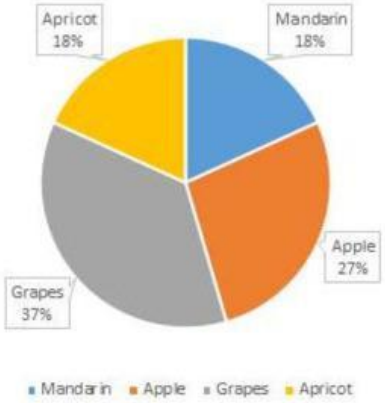

C.

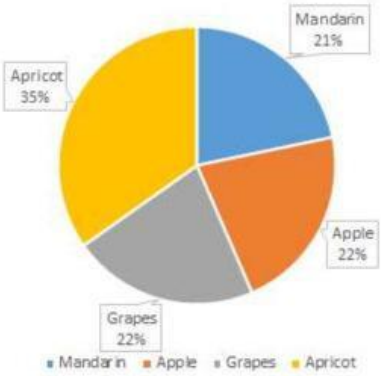

D

LIVEWORKSHEETS