S1 Measure Assessment Revision

1. Calculate the perimeter of the following:

a)

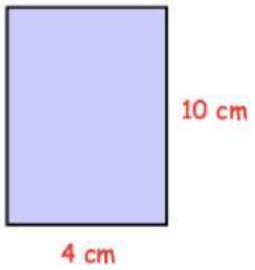

_____ cm

b)

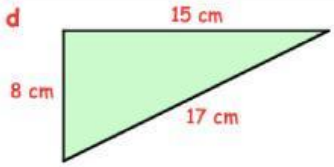

_____ cm

c)

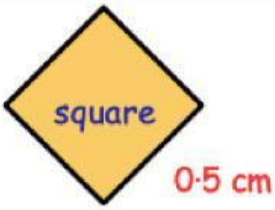

_____ cm

d)

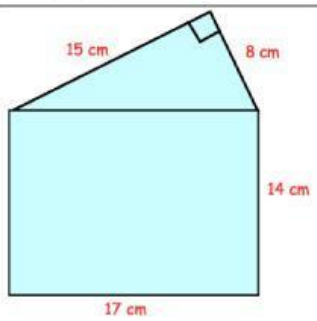

_____ cm

e)

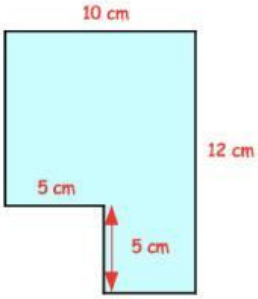

_____ cm

f)

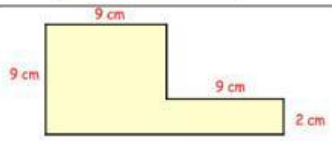

_____ cm

2. Calculate the area of the following:

a)

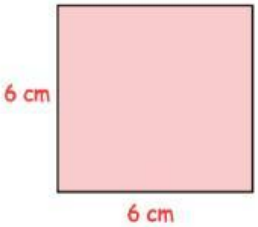

_____ cm^2

b)

_____ cm^2

c)

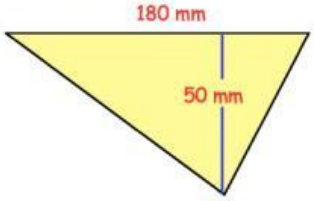

_____ mm^2

d)

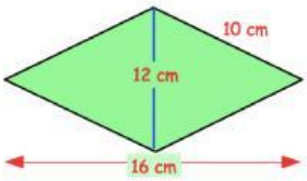

_____ cm^2

e)

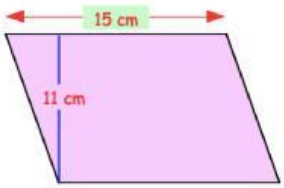

_____ cm^2

f)

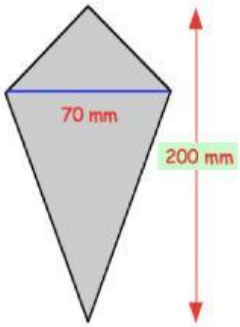

_____ mm^2

LIVEWORKSHEETS

g)

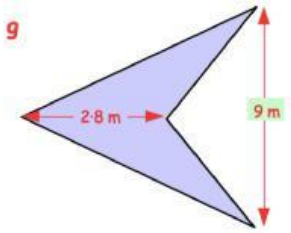

_____ m^2

h)

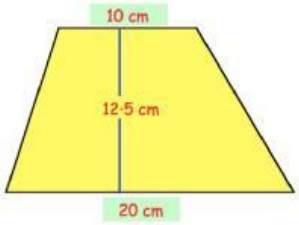

_____ cm^2

i)

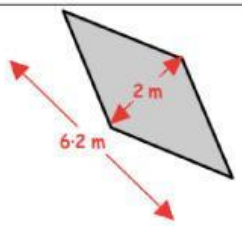

_____ m^2

3. Calculate the area of the following:

a)

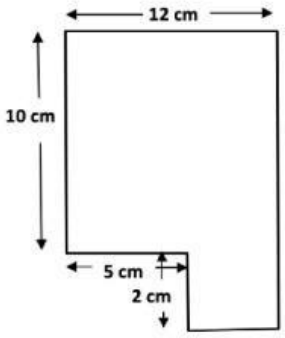

_____ cm^2

b)

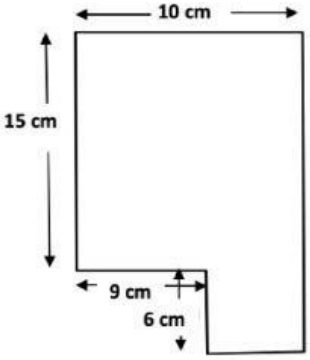

_____ cm^2

4. For the following:
   i) Calculate the volume in cm^3
   ii) Calculate its capacity in millilitres
   iii) Calculate its capacity in litres

a)

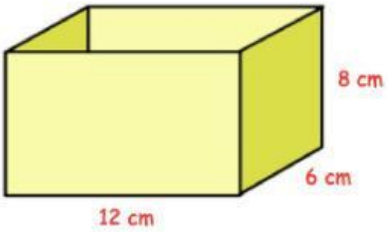

i) _____ cm^3

ii) _____ ml

iii) _____ $litres$

b)

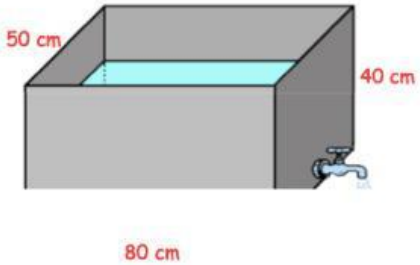

i) _____ cm^3

ii) _____ ml

iii) _____ $litres$

LIVEWORKSHEETS