NAMA: **KELAS:**

Tonton video di bawah.

Pilih jawapan yang betul

1

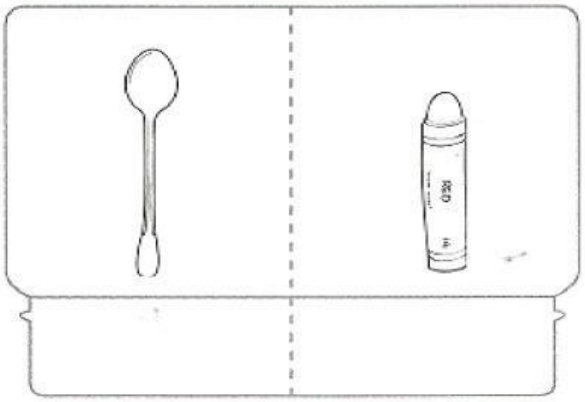

2

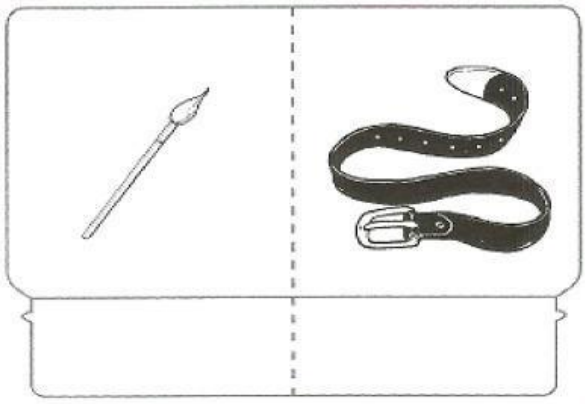

1



2



LIVEWORKSHEETS

Pilih jawapan yang betul

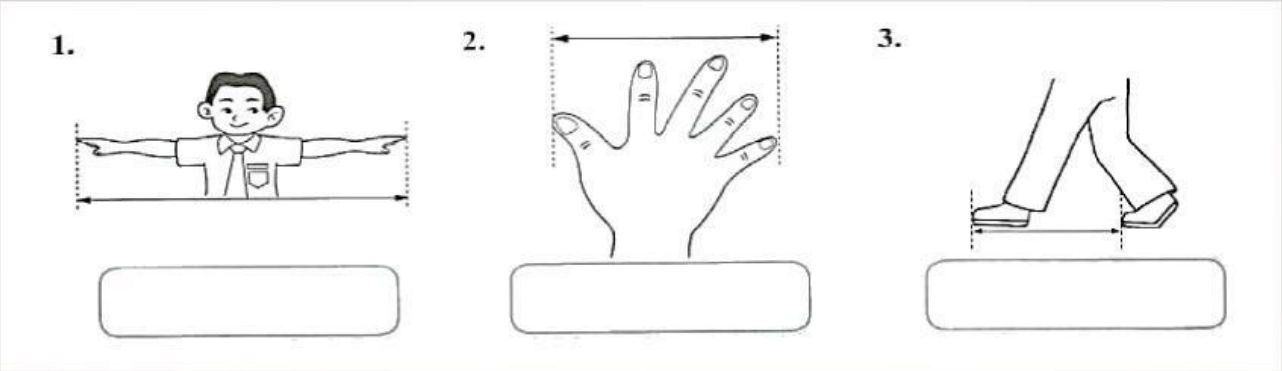

Tarik jawapan dan letakkan dalam ruang yang disediakan.

pendek	4	kapur	7	pemutar skru	panjang

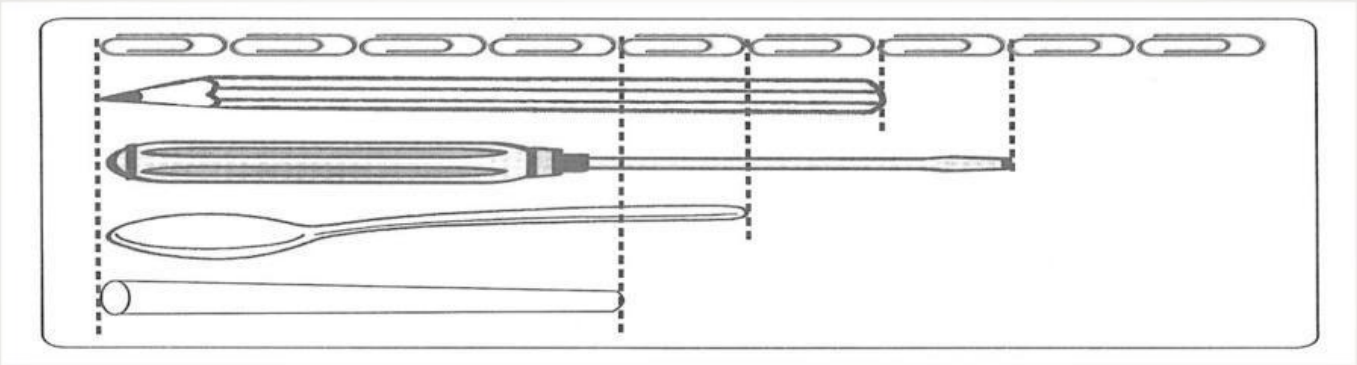

1. Panjang pemutar skru sama dengan _____ .
2. Panjang kapur sama dengan _____ .
3. Sudu lebih _____ daripada kapur.
4. Pensel lebih _____ daripada pemutar skru.
5. Objek yang paling pendek ialah _____ .
6. Objek yang paling panjang ialah _____ .

Selamat menjawab

Cikgu Rozaidu

LIVEWORKSHEETS