Congruency

Complete the Congruence statement for each Pair of triangles

1)

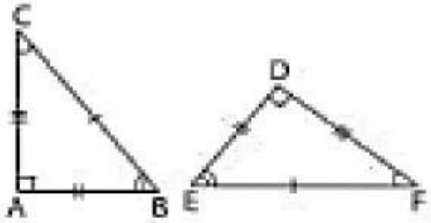

Δ ABC ≡ Δ

2)

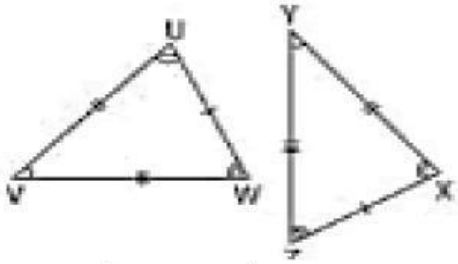

Δ UVW≡ Δ

3)

Δ PQR ≡ Δ

4)

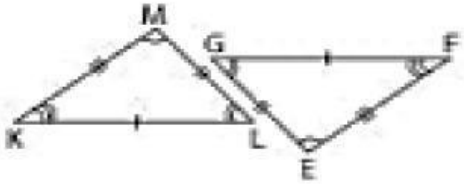

Δ KLM≡ Δ

5)

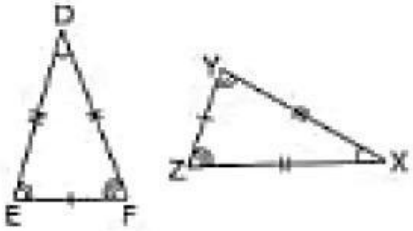

Δ DEF≡ Δ

6)

Δ TUV≡Δ

7)

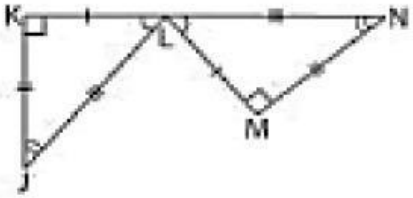

Δ KL J≡ Δ

LIVEWORKSHEETS