CEIP LA VIÑA (ZAMORA)
NATURAL SCIENCE / YEAR 5

The nervous system

Label the parts of the central nervous system:

- skull
- spinal cord
- brainstem
- cerebellum
- spinal column
- brain

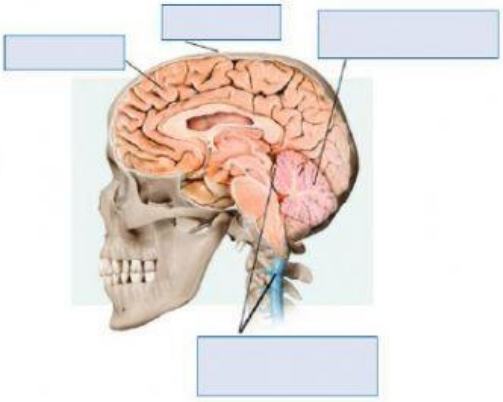

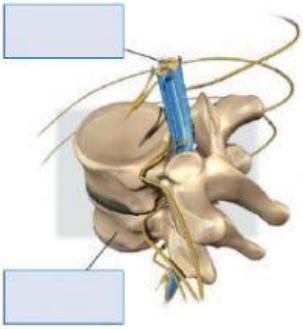

What part of the encephalon carries out these functions?

The _____ processes information and generates orders.

The _____ controls voluntary movements (e.g. walking) and balance.

The _____ controls automatic movements (e.g. breathing or heart rate)

LIVEWORKSHEETS

The peripheral nervous system. Complete the diagram:

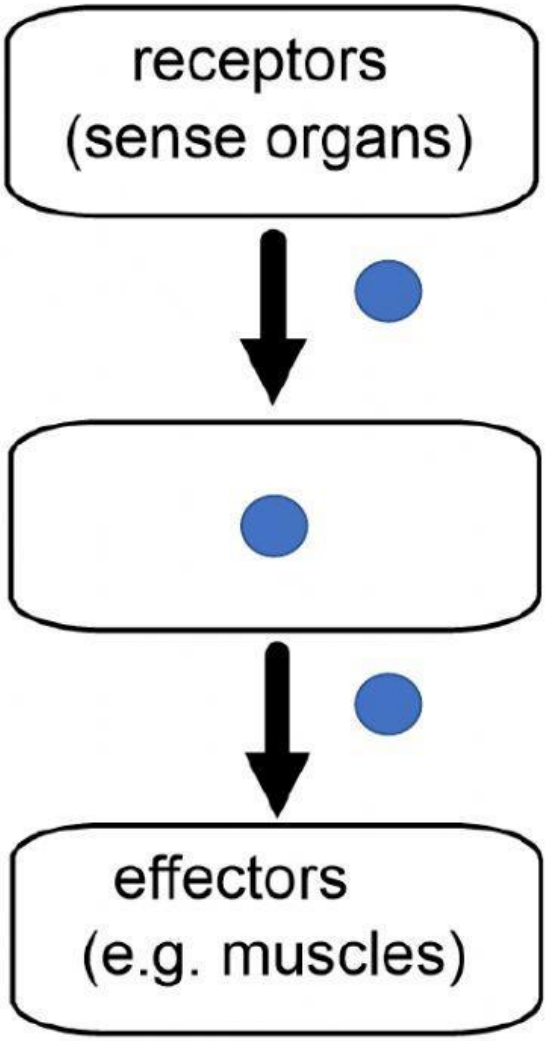

central nervous system

motor nerves

sensory nerves

LIVEWORKSHEETS