PRAKTIS KENDIRI 2

A Namakan pergerakan lokomotor dalam gambar di bawah. Kemudian, lakukan pergerakan tersebut. SP 1.2.1 SP 2.2.1 SP 5.1.2 TP 1

Melonjak | Berskip | Mencongklang | Berlari

1.

2.

Pergerakan Lokomotor

3.

4.

LIVEWORKSHEETS

Nama: _____ Tarikh: _____

C. Namakan pergerakan lokomotor di bawah. Kemudian, lakukan pergerakan tersebut. SP 1.2.1 SP 1.2.2 SP 1.2.3 SP 5.2.1 TP 2 TP 3

Lari dan Lonjak	Lompat tali
Lompat sebelah kaki	Lompat dua belah kaki

Pergerakan Lokomotor

1.



2.

3.



4.



LIVEWORKSHEETS