Name: _____ Date: _____

LESSON 6.4: AREA OF SQUARES AND RECTANGLES

Learning Objective: I can find the area of squares and rectangles by multiplying.

Find the AREA of each figure.

1)

Area = _____square cm

2)

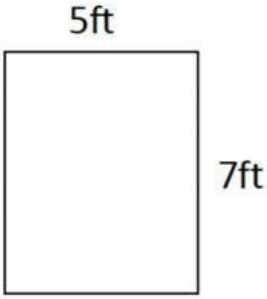

Area = _____square ft

3)

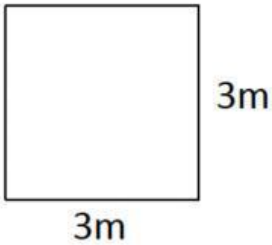

Area = _____square m

4)



Area = _____square in

5)



Area = _____square m

6)



Area = _____square cm

LIVEWORKSHEETS