Using the 5 times table

How many altogether?

Georgia had 7 cats. Each cat had 5 kittens.
How many kittens were there altogether?

7 x 5 = 35 kittens

How many altogether?

Charlie had 6 boxes. He had 5 trains in each box. How many trains did he have altogether?



☐ x ☐ = ☐ trains

Zoe had 3 jackets. Each jacket had 5 buttons. How many buttons were there altogether?

☐ x ☐ = ☐ buttons

Yan had 8 fish tanks. Each tank had 5 fish in it. How many fish were there altogether?



☐ x ☐ = ☐ fish

How many in each?

Joe had 45 pencils and 5 pencil cases.
How many pencils were in each case?

45 ÷ 5 = 9 pencils

How many in each?



Heather had 10 mice and 5 cages.
How many mice were in each cage?

☐ ÷ ☐ = ☐ mice

Shannon had 35 candies in 5 bags.
How many candies were in each bag?

☐ ÷ ☐ = ☐ candies

Mark put 25 seeds into 5 pots.
How many seeds were in each pot?

☐ ÷ ☐ = ☐ seeds

© Dorling Kindersley Limited [2010] DK

GREAT!SCHOOLS

LIVEWORKSHEETS

Using the 5 times table

How many altogether?

Georgia had 7 cats. Each cat had 5 kittens. How many kittens were there altogether?

7 x 5 = 35 kittens

How many altogether?

Charlie had 6 boxes. He had 5 trains in each box. How many trains did he have altogether?



6 x 5 = 30 trains

Zoe had 3 jackets. Each jacket had 5 buttons. How many buttons were there altogether?

3 x 5 = 15 buttons

Yan had 8 fish tanks. Each tank had 5 fish in it. How many fish were there altogether?



8 x 5 = 40 fish

How many in each?

Joe had 45 pencils and 5 pencil cases. How many pencils were in each case?

45 ÷ 5 = 9 pencils

How many in each?



Heather had 10 mice and 5 cages. How many mice were in each cage?

10 ÷ 5 = 2 mice

Shannon had 35 candies in 5 bags. How many candies were in each bag?

35 ÷ 5 = 7 candies

Mark put 25 seeds into 5 pots. How many seeds were in each pot?

25 ÷ 5 = 5 seeds

© Dorling Kindersley Limited [2010]

DK

GREAT SCHOOLS

LIVEWORKSHEETS