برنامج التعلم الذاتي
Self-Learning Program

Name: .....
School: .....
Class: Grade 3
Subject: Math. Title: Fractions

Interactive Worksheet: Week 16 / Self-Learning Program

Match each figure where the colored part represents the given fraction

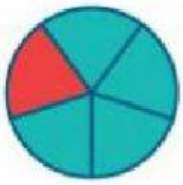

$\frac{1}{3}$

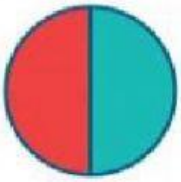

$\frac{1}{4}$

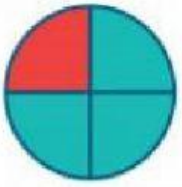

$\frac{1}{5}$

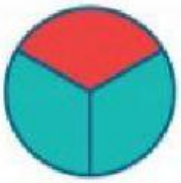

$\frac{1}{2}$

LIVEWORKSHEETS

Write the fraction that represents the colored part by drag and drop

$\frac{1}{8}$ $\frac{1}{6}$ $\frac{1}{7}$

LIVEWORKSHEETS

Circle the figure where the colored part represents the given fraction



$\frac{1}{4}$

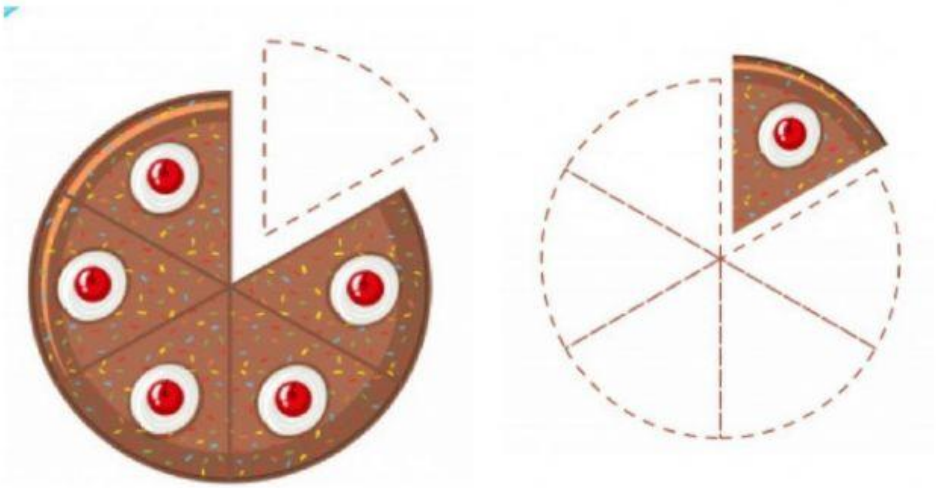

$\frac{1}{6}$

$\frac{1}{8}$

LIVEWORKSHEETS