UNIT 9 & 10 – PRACTICE

1. Round the 4 digit numbers:

Round 8575 to the nearest 10	
Round 7686 to the nearest 100	
Round 4629 to the nearest 1000	
Round 5355 to the nearest 1000	

2. Put the numbers in order from smallest to greatest:

7367	7462	9274	2648	4553	4562

3. Use < and > to compare the following numbers:

6334 6252	9778 8963	2409 3203

4. Divide the 2 digit numbers with remainders:

65 ÷ 7 =_____r _____	70 ÷ 5 =_____r _____
88 ÷ 8 =_____r _____	44 ÷ 7 =_____r _____

5. Answer the following division word problems:

Apples cost $1 each. How many apples can Tony buy with $12?	
Dream buys 3 boxes of pencils. Each box contains 12 pencils. How many pencils does he have in total?	
A train holds 30 people. If 90 people go on a trip, how many trains are needed?	
Mr. Edward wants to buy a new laptop. It costs $500. If he saves $75 each week, how many weeks will it take for him to save up the money?	

LIVEWORKSHEETS

6. Complete the division wheels:

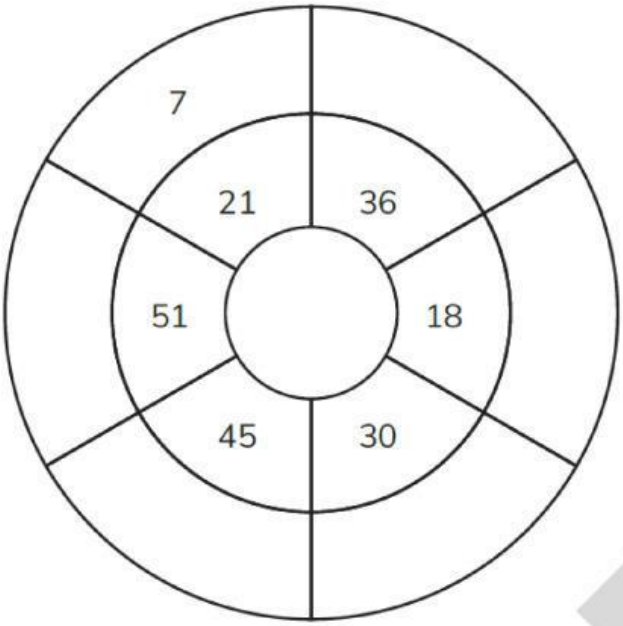

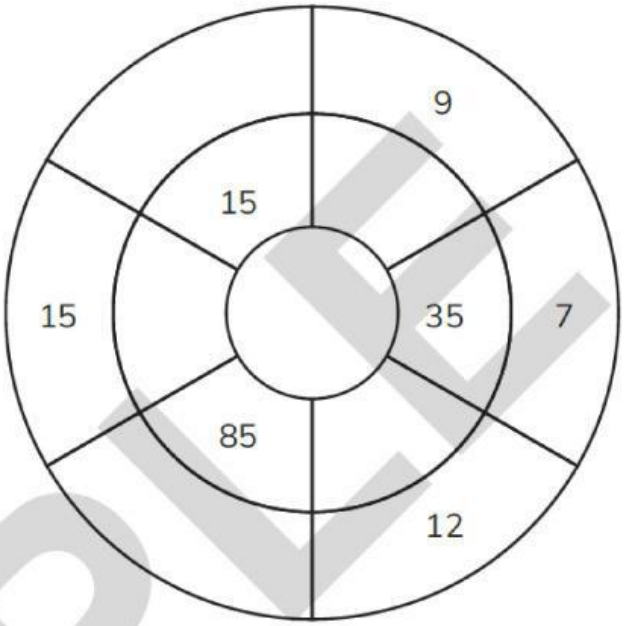

7. Ken counted the number of cars that drove past his apartment each morning. Complete the table to show how many days he saw each number of cars:

4, 4, 4, 4, 5, 5, 5, 5, 6, 6, 6 ,8, 8, 9, 9, 9, 9,9

Number of cars	How many days?
4	
5	
6	
8	
9	

8. Answer the questions about the dot plot below:

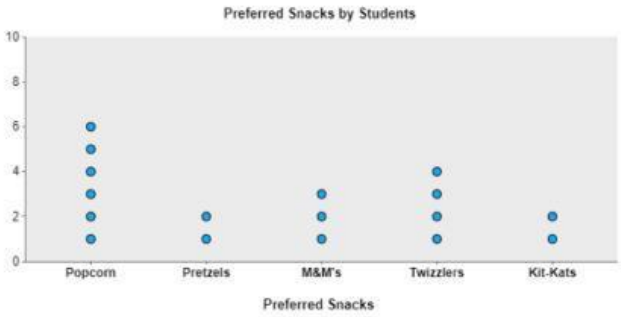

Which was the most popular snack?	
Which were the two least popular snacks?	
How many students liked popcorn and M&M's ?	
How many students ate snacks in total?	

LIVEWORKSHEETS