Nama :

Lengkapkan latihan ini mengikut nilai tempat yang betul.



ratus	puluh	sa



ratus	puluh	sa

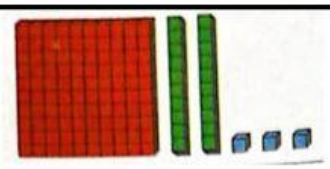

ratus	puluh	sa

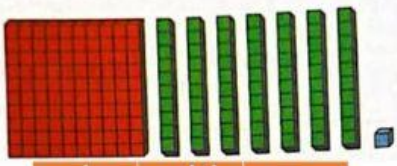

ratus	puluh	sa

ratus	puluh	sa

ratus	puluh	sa

LIVEWORKSHEETS