Nama : .....

Kelas : .....

Lambang Bilangan

Pasangkan lambang bilangan dengan nama bilangan yang tepat.

931 •	Dua ratus lima puluh delapan
258 •	Seratus tiga puluh lima
139 •	Lima ratus tujuh puluh tiga
350 •	Dua ratus delapan puluh lima
285 •	Empat ratus sembilan puluh dua
135 •	Seratus tiga puluh sembilan
571 •	Sembilan ratus tiga puluh satu
492 •	Tiga ratus lima puluh
573 •	Lima ratus tujuh puluh satu

LIVEWORKSHEETS

Nama: Kelas:

Nama Bilanganku

Tuliskan nama bilangan yang ada pada gambar ikan.



.....



.....



.....



.....



.....

LIVEWORKSHEETS