Nama: _____ Kelas: _____

Padankan nombor dengan bilangan objek yang betul.

1. 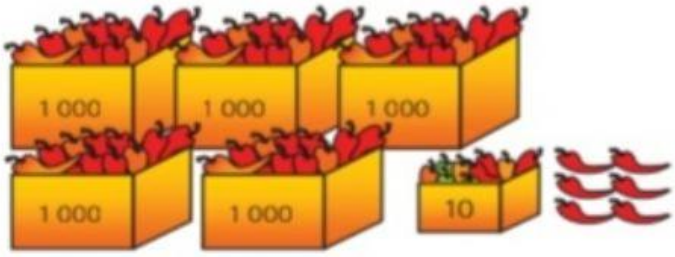

3113

2. 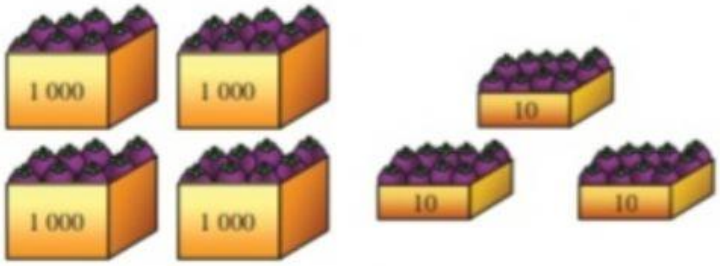

5602

3. 

5016

4. 

4030

5. 

2043