Quadriláteros

Nome: _____

Nome: Não-trapézio

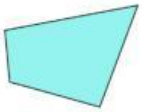

Nome: _____

Trapézios propriamente ditos

Nome:

Trapézio isósceles

Nome: _____

Nome: _____

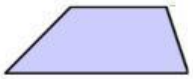

Losango

Nome: _____

Quadrado



Coloca os nomes em falta em cada quadrilátero:

Retângulo | Paralelogramo | Trapézio | Trapézio retângulo | Trapézio escaleno

LIVEWORKSHEETS