INTERNATIONAL SCHOOL

Subject: Mathematics

Teacher Karen Fonseca

Date: Friday, November 17, 2023.

Name_____

Level: 1st GRADE

Points: _____/28

1. Add.

(a) 3 + 3 = _____ (b) 7 + 7 = _____

(c) 4 + 4 + 4 = _____ (d) 5 + 5 + 5 = _____

(e) 8 + 8 = _____ (f) 2 + 2 + 2 = _____

2. 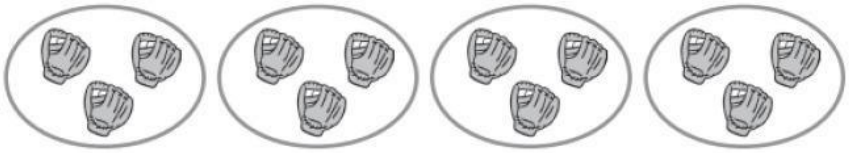

3 + 3 + 3 + 3 = _____

4 threes = _____

3. 

7 + 7 + 7 = _____

3 sevens = _____

4. 

_____ + _____ + _____ + _____ = _____

_____ fours = _____

There are _____ tops altogether.

LIVEWORKSHEETS

Look at the picture.
Then fill in the blanks.

1. There are 3 bowls.
Each bowl has 2 bananas.
How many bananas are there altogether?

2 + 2 + 2 = _____

3 × 2 = _____

There are _____ bananas altogether.

2. Lihua has 2 boxes.
There are 5 crayons in each box.
How many crayons does she have altogether?

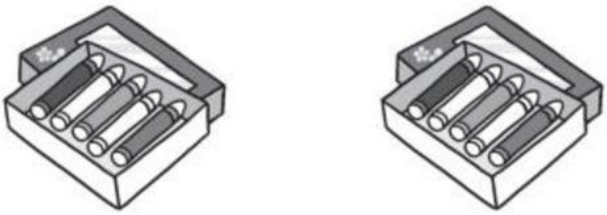

_____ + _____ = _____

_____ × _____ = _____

Lihua has _____ crayons altogether.

LIVEWORKSHEETS