A
S
S
P

Name:_____ Grade:_____ Date:_____

Reflections

5. Reflect the point (2, -4) over the y-axis.

- ○ (-4, 2)
- ○ (-2, 4)
- ○ (-2, -4)
- ○ (2, 4)

6. Reflect (6, -3) over the line x-axis.

- ○ (6, 3)
- ○ (-6, -3)
- ○ (-3, 6)
- ○ (3, -6)

7. Reflect Point C over the y-axis:

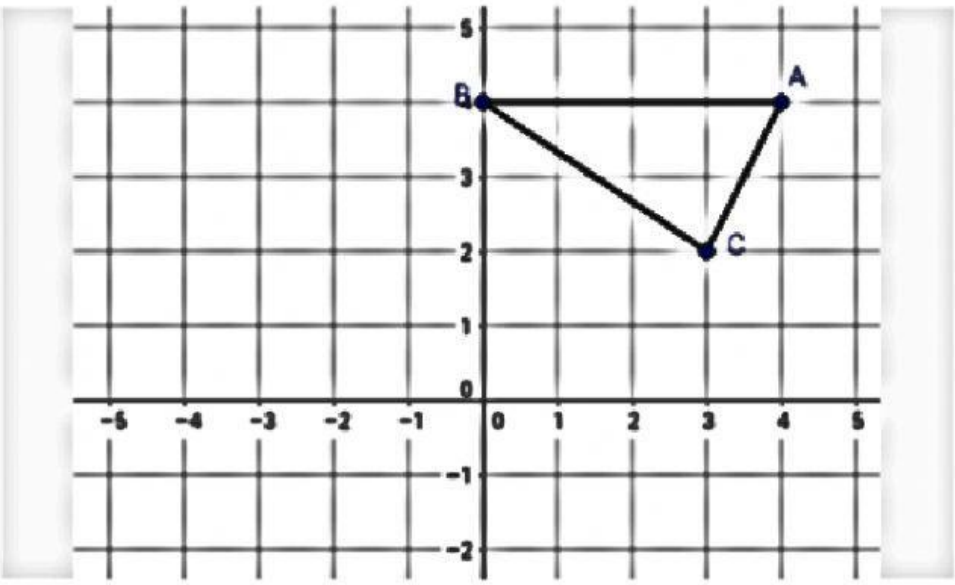

- ○ (-3, 2)
- ○ (3,2)
- ○ (-2,3)
- ○ (3,0)

LIVEWORKSHEETS

11. What would be the coordinates of point K if it was reflected over the Y-axis?

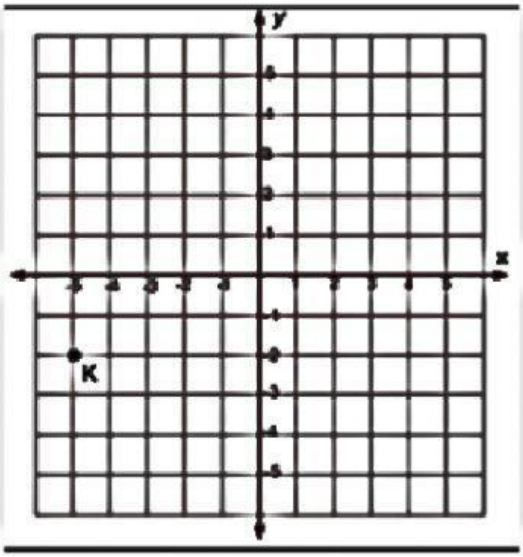

- (-5, 2)
- (5, 2)
- (5, -2)

13. True or false: A reflection changes the size of a figure.

- True
- False

12. Find K' if the figure is reflected across the x-axis

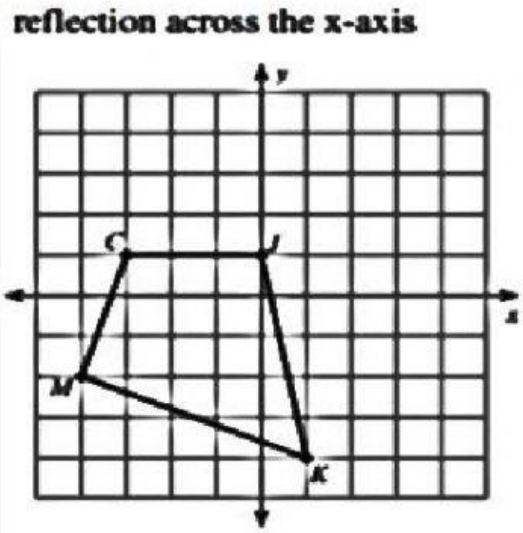

- (4, 1))
- (-1, -4)
- (1, -4)
- (1, 4)

LIVEWORKSHEETS