ใบงานประจำหน่วยการเรียนรู้เรื่อง ความเท่ากันทุกประการ

เรื่อง ความสัมพันธ์แบบ ฉาก- ด้าน -ด้าน

ชื่อ..... เลขที่ ..... ชั้น.....

คำชี้แจง ให้นักเรียนบอกว่ารูปสามเหลี่ยมในแต่ละข้อนี้เท่ากันทุกประการ โดยมีความสัมพันธ์แบบใด

1)

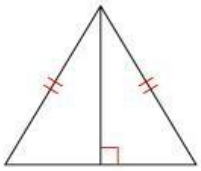

2)

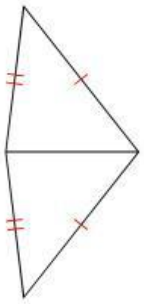

3)

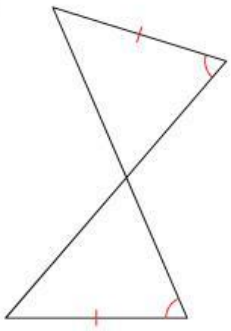

4)

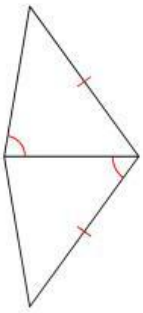

5)

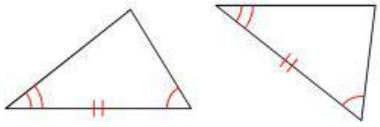

6)

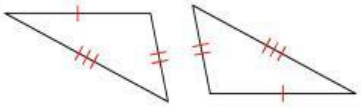

7)

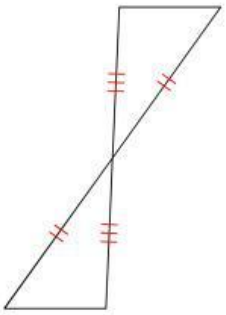

8)

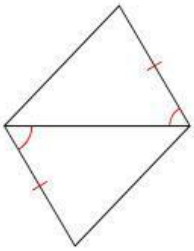

9)

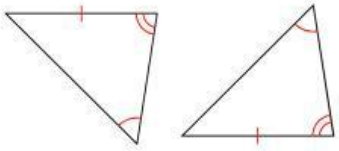

LIVEWORKSHEETS

10)

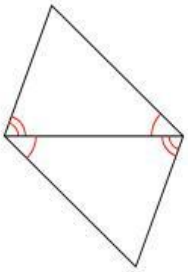

11)

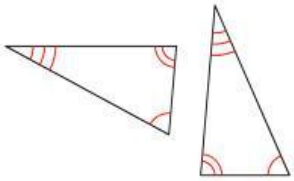

12)

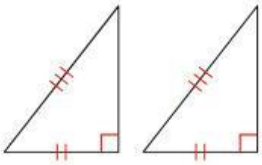

13)

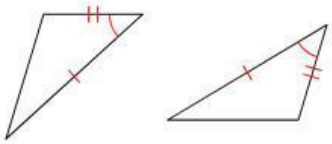

14)

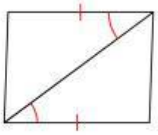

15)

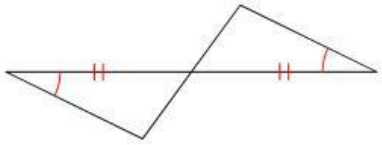

16)

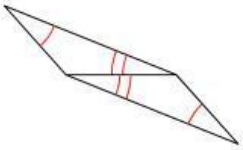

17)

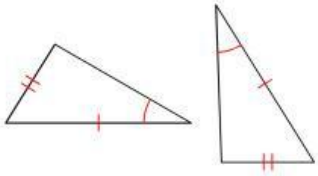

18)

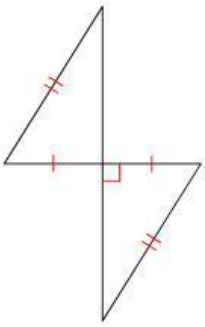

19)

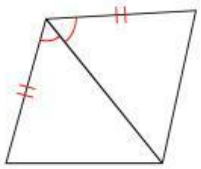

20)

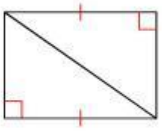

21)

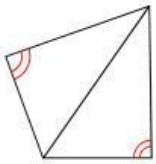

LIVEWORKSHEETS

22)

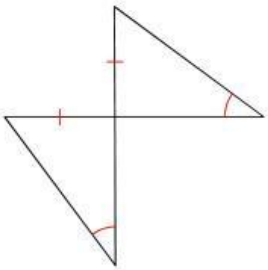

23)

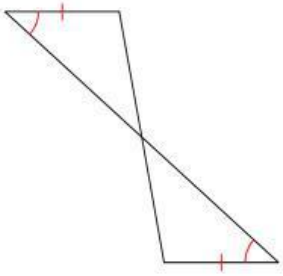

24)

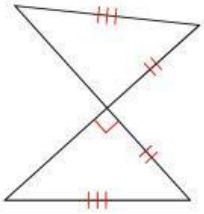

25)

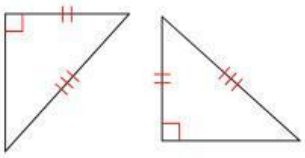

26)

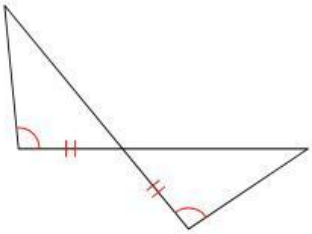

27)

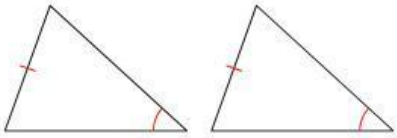

28)

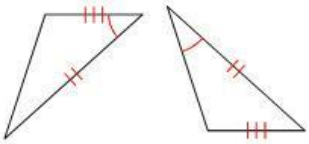

29)

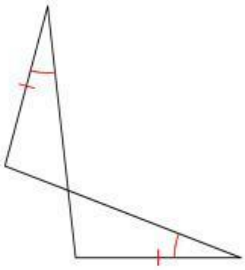

30)

31)

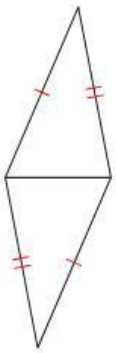

LIVEWORKSHEETS

32)

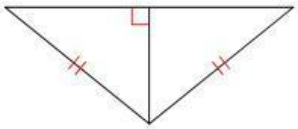

33)

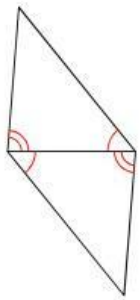

34)

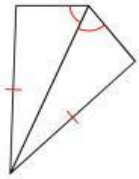

35)

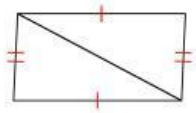

36)

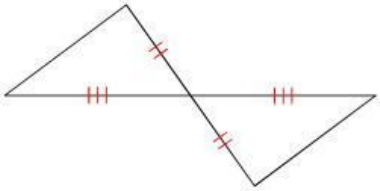

37)

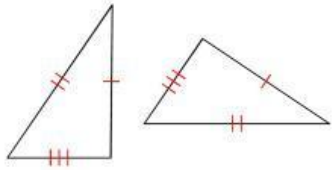

38)

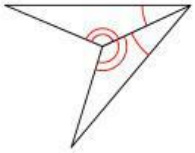

39)

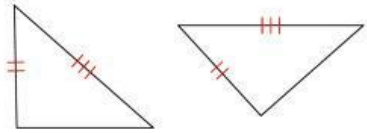

40)

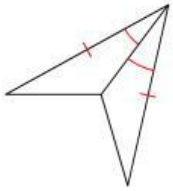

LIVEWORKSHEETS