Fractions

- Write the fractions of the sliced circles next to them.

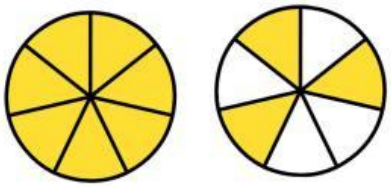

___ OR ___

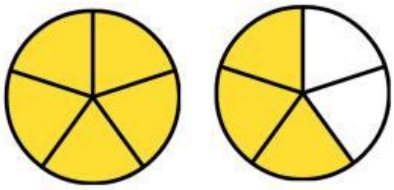

___ OR ___

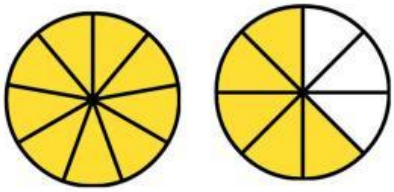

___ OR ___

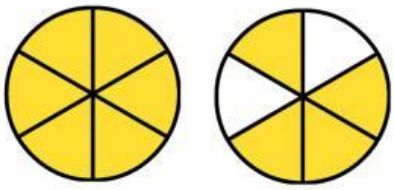

___ OR ___

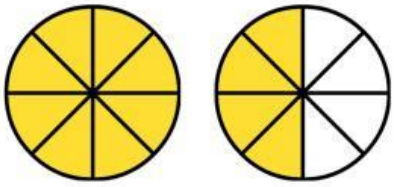

___ OR ___

LIVEWORKSHEETS