Name : _____ Score : _____

Area and Perimeter of L Shapes

Find the area and perimeter of each shape.

1)

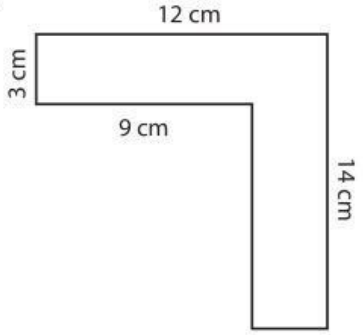

Area: _____ cm^2
Perimeter: _____ cm

2)

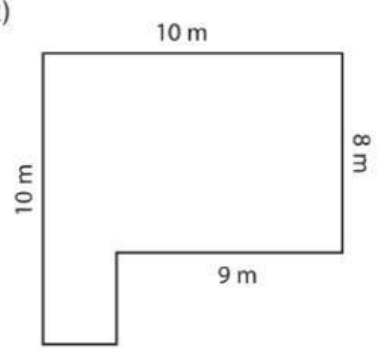

Area: _____ m^2
Perimeter: _____ m

4)

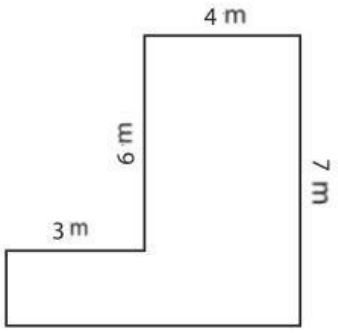

Area: _____ m^2
Perimeter: _____ m

5)

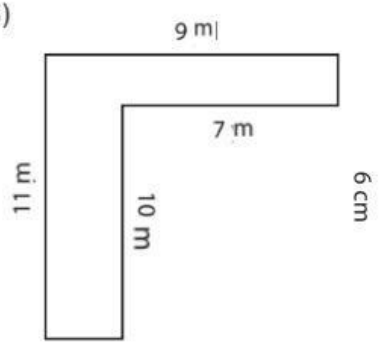

Area: _____ m^2
Perimeter: _____ m

7)

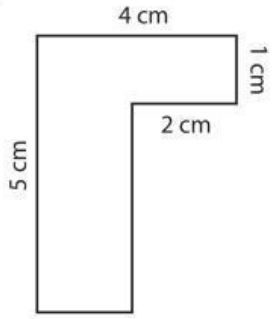

Area: _____ cm^2
Perimeter: _____ cm

8)

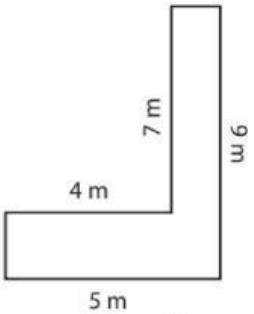

Area: _____ m^2
Perimeter: _____ m

LIVEWORKSHEETS