Angle properties

Name the angles formed by 2 parallel lines and a transversal using the words alternate angle, corresponding angle, vertically opposite angle and co-interior angle.

1.

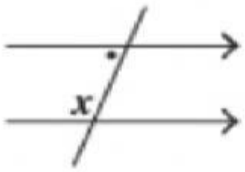

2.

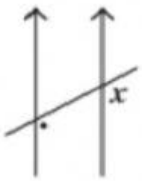

3.

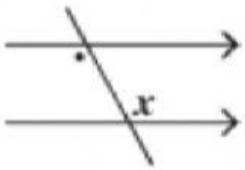

4.

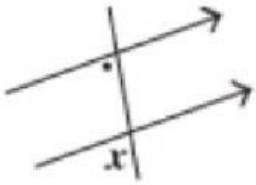

5.

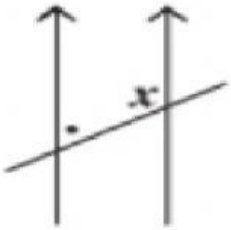

6.

7.

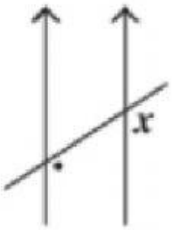

8.

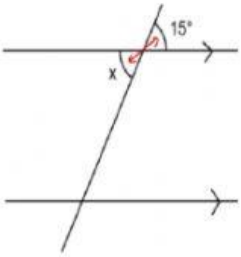

9.

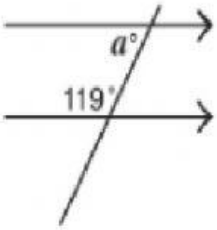

LIVEWORKSHEETS

LIVEWORKSHEETS