Name: _____
Date:_____

Multiplying Using Area Models

	Array	Steps & Solve
Q 1	Use the array to find the product of 14x3 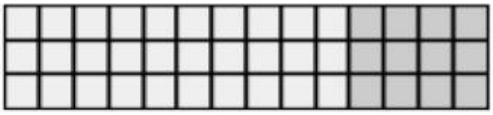	
	14 x 3 = Ones: 4 Equal: 4 Tens: 1 Equal: 10	(10 X 3 = 30) + (4 X 3 = 12) 30 + 12 = _____
Q 2	Use the array to find the product of 11x6 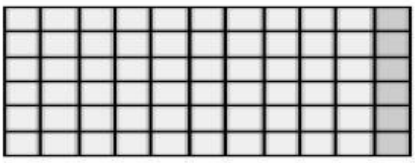	
	11 x 6 = Ones: Equal: Tens: Equal:	(___ X 6 =___) + (___ X 6 =___) _____ + _____ = _____
Q 3	Use the array to find the product of 13x3 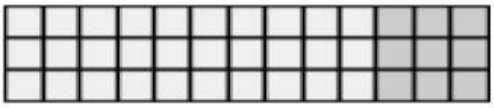	
	13 x 3 = Ones: Equal: Tens: Equal:	(___ X 3 = ___) + (___ X 3 = ___) _____ + _____ = _____

LIVEWORKSHEETS

Q4	Use the array to find the product of 16x4 	
	16 x 4 = Ones: Equal: Tens: Equal:	(___ X 4 = ___) + (___ X 4 = ___) _____ + _____ = _____
Q 5 Bonus	Use the array to find the product of 15x5 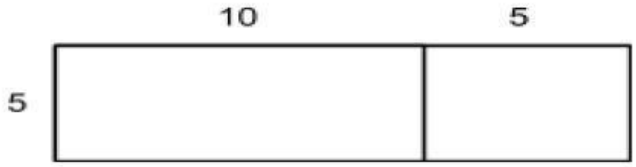	
	15 x 5 = Ones: Equal: Tens: Equal:	(___ X 5 = ___) + (___ X 5 = ___) _____ + _____ = _____
Q 6 Bonus	Use the array to find the product of 22x6 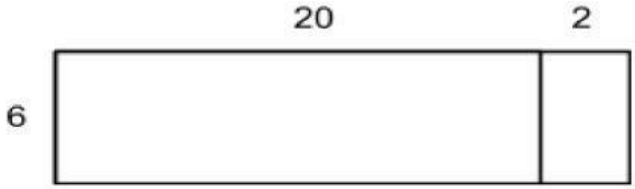	
	22 x 6 = Ones: Equal: Tens: Equal:	(___ X 6 = ___) + (___ X 6 = ___) _____ + _____ = _____

LIVEWORKSHEETS