LKPD-BIOMA

Nama : _____ Kelas : _____

Geserlah tulisan sesuai dengan gambar yang menunjukan bioma yang tepat.

hutan hujan | Gurun | Stepa

Taiga | Tundra | Sabana

By Sunardi

LIVEWORKSHEETS

SEBARAN BIOMA

EXPLORE

1

2

3

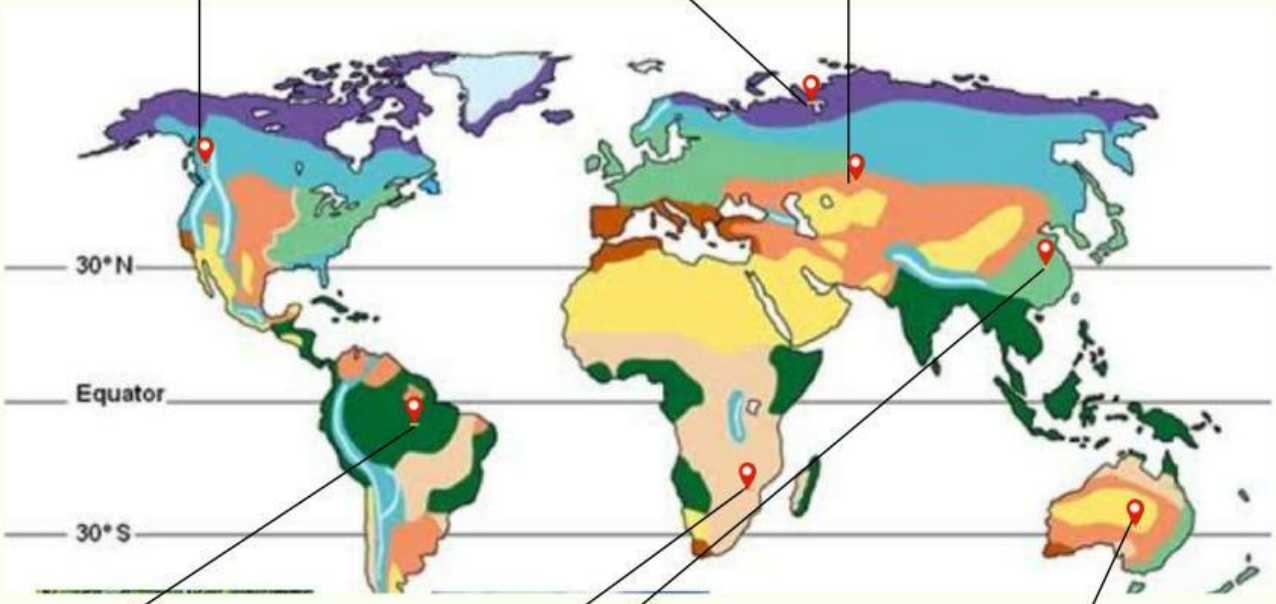

4

5

6

7

By Sunardi

LIVEWORKSHEETS

biota dan bioma

buat garis untuk pasangan yang sesuai



hutan hujan

Gurun

sabana



Stepa

Tundra

LIVEWORKSHEETS
By Suhardi