Guía Fracciones Impropias y Números Mixtos

1. Escribe la fracción impropia y el número mixto que corresponde a cada representación gráfica.

Representación gráfica	Fracción Impropia	Número Mixto
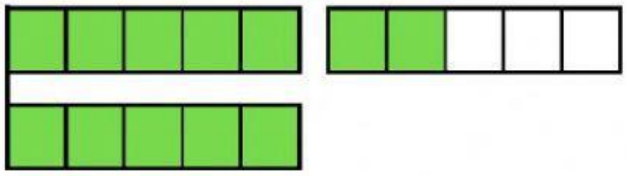		
		
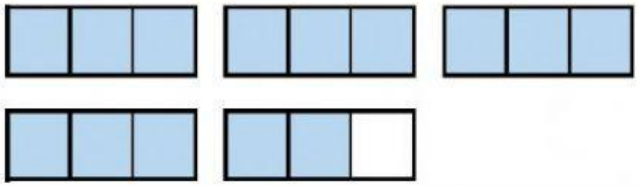		
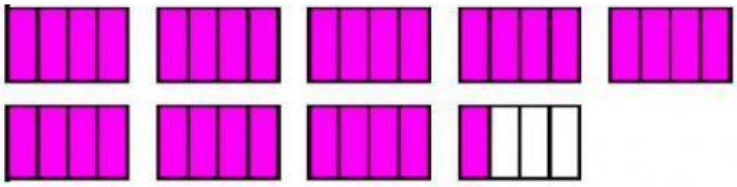		
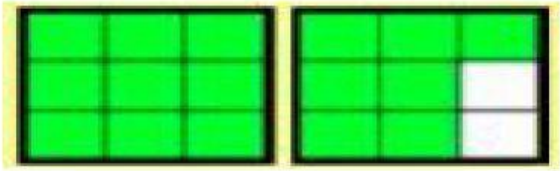		
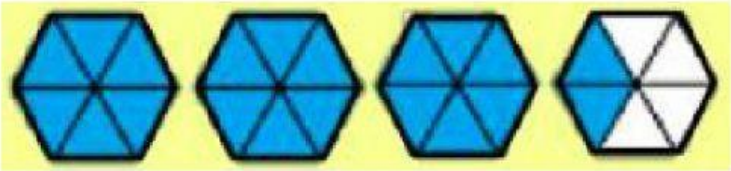		
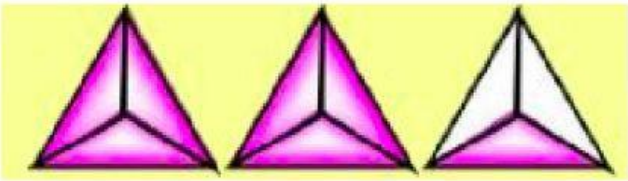		

LIVEWORKSHEETS

2. Selecciona la fracción impropia o número mixto que corresponda para mantener la igualdad.

a) $\frac{13}{5} =$ $4\frac{1}{3}$ $4\frac{4}{5}$ $2\frac{3}{5}$ $2\frac{5}{3}$

b) $2\frac{3}{9} =$ $\frac{21}{9}$ $\frac{23}{9}$ $\frac{6}{9}$ $\frac{9}{23}$

c) $3\frac{1}{4} =$ $\frac{31}{4}$ $\frac{8}{4}$ $\frac{11}{4}$ $\frac{13}{4}$

d) $\frac{15}{7} =$ $1\frac{5}{7}$ $2\frac{1}{7}$ $8\frac{7}{5}$ $2\frac{7}{5}$

e) $\frac{25}{8} =$ $2\frac{5}{8}$ $5\frac{8}{2}$ $3\frac{1}{8}$ $2\frac{8}{9}$

f) $4\frac{1}{2} =$ $\frac{9}{2}$ $\frac{2}{9}$ $\frac{7}{2}$ $\frac{2}{4}$

LIVEWORKSHEETS