TRANSFORMASI GEOMETRI
(Refleksi)

Nama :

Kelas :

Sekolah :

1. Perhatikan video dibawah ini!

Setelah menonton video di atas, apa yang kamu ketahui tentang transformasi geometri?

2. Tentukan hasil bayangan titik A (2,3) jika titik A dicerminkan terhadap sumbu x...

a. A'(-3,2)

b. A'(2,-3)

c. A' (-2,3)

d. A'(3,2)

e. A' (-3,-2)

LIVEWORKSHEETS

3. **Jika titik P(4,-2) di cerminkan terhadap titik O(0,0) akan menghasilkan bayangan P'(-2,4)**

   Benar

   Salah

4. **Jodohkanlah gambar dibawah ini dengan tepat jika dicerminkan terhadap garis y=-x**

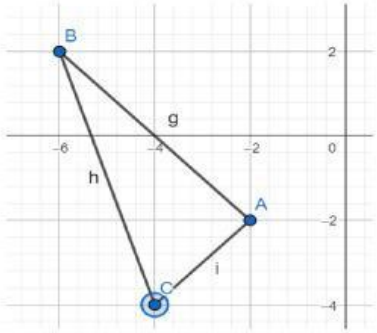

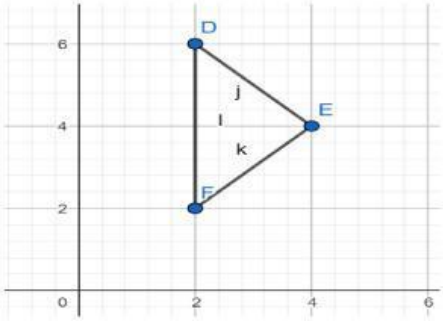

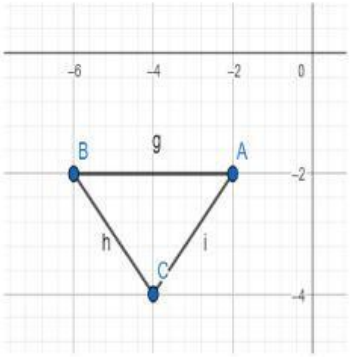

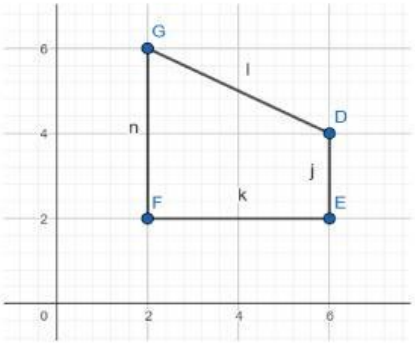

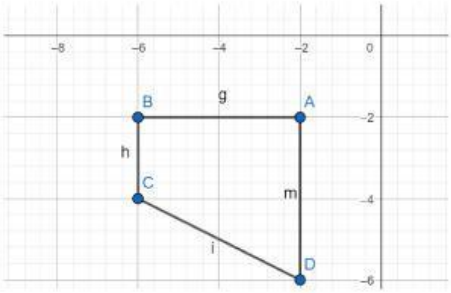

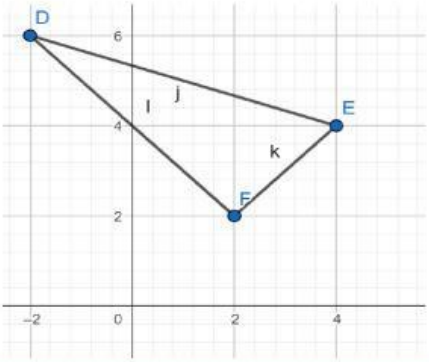

LIVEWORKSHEETS

LIVEWORKSHEETS