Immune System Assessment Sheet

Student Name: _____ Date: _____

Put the numbers 1–6 in the circles to show the order in which your immune system works.



A A white blood cell starts to surround a bacterium or virus.



B An antibody recognizes a bacterium or virus and sticks to it.



C The white blood cell completely surrounds the bacterium or virus and eats it.



D Bacteria or viruses, enter your body.



E The bacterium or virus is destroyed, so the risk of disease is reduced.



F Your body makes special chemicals, called antibodies. These are released into the bloodstream.

Permission granted to photocopy for classroom use only … GTK Pre