Name: _____ Date: _____ Score: ____

Name the Fraction #1

1.

2.

3.

4.

5.

6.

7.

8.

LIVEWORKSHEETS

Name: _____ Date: _____ Score: ____

Name the Fraction #2

1.

2.

3.

4.

5.

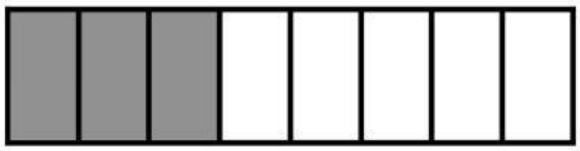

6.

7.

8.

Ayo belajar di Sekolah Merdeka Belajar AccocadoMY "It's a place to see"

LIVEWORKSHEETS

Name: _____ Date: _____ Score: ____

Fractions on a Number Line #3

1.

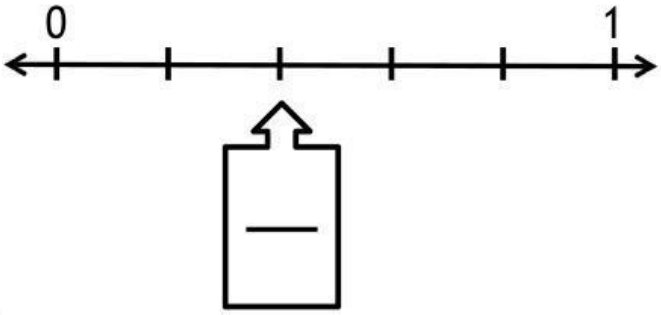

2.

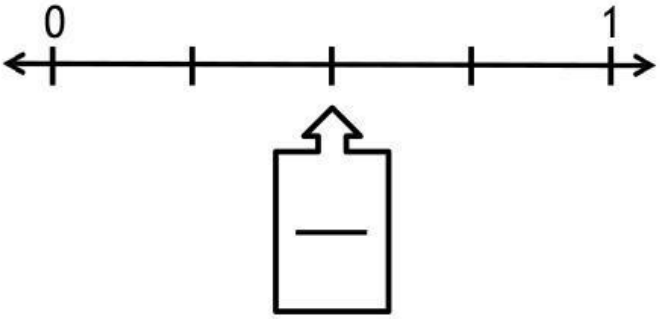

3.

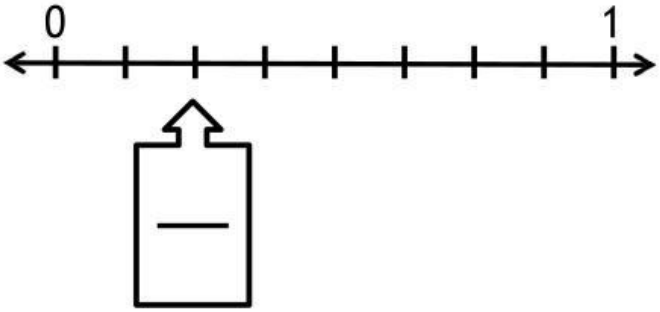

4.

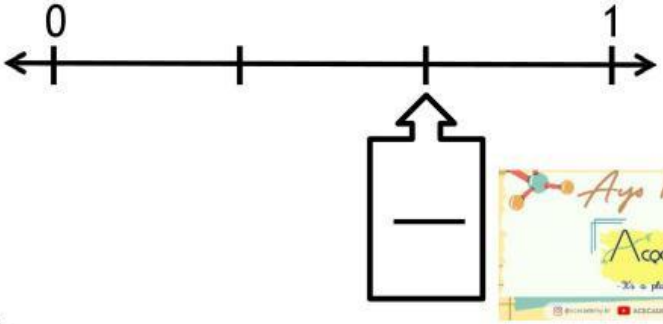

5.

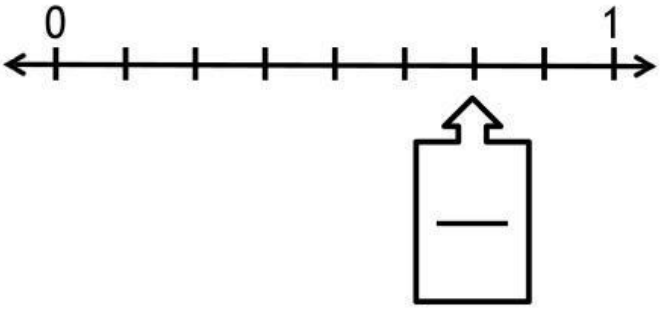

6.

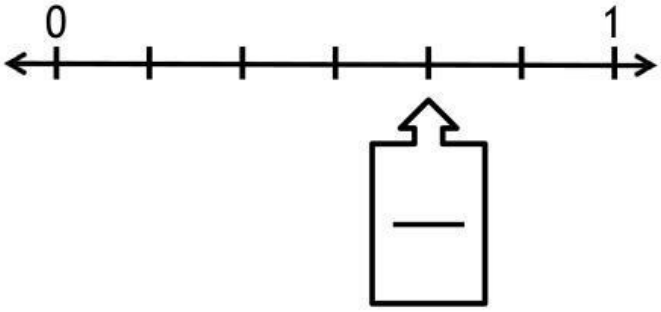

7.

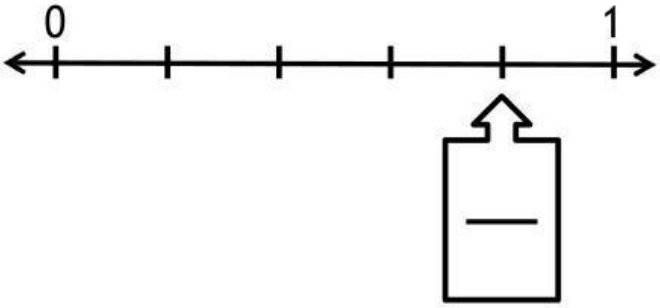

8.

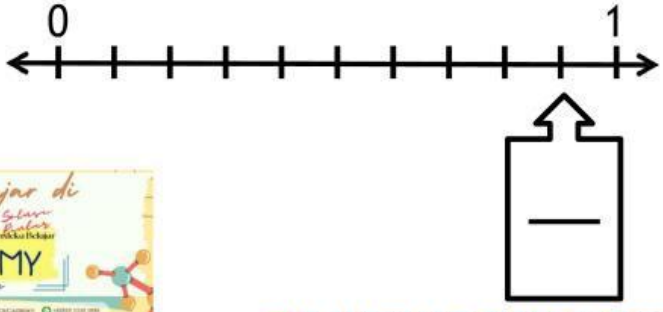

Ayo belajar di
Sekolah Belajar Menyenangkan
AcocadoMY
-It's a place to see-

LIVEWORKSHEETS

Name: _____ Date: _____

Fractions on a Ruler

Directions: For each ruler section, find A, B, and C.

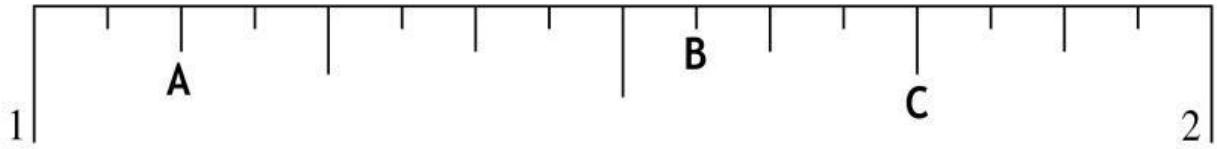

A: _____ B: _____ C: _____

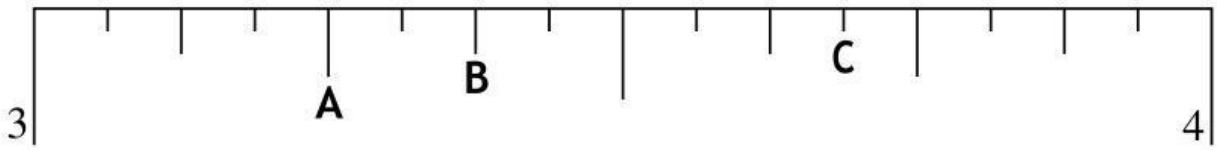

A: _____ B: _____ C: _____

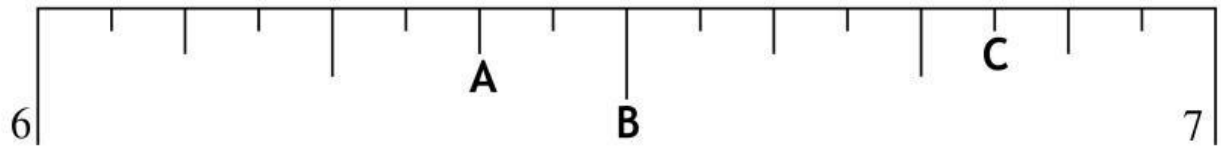

A: _____ B: _____ C: _____

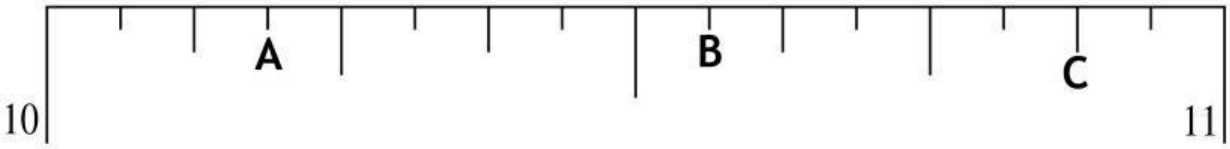

A: _____ B: _____ C: _____

LIVEWORKSHEETS

Equivalent Fractions: Denominators of 10 & 100

To find equivalent fractions when the numerators and/or denominators are multiples of 10 or 100, you can multiply or divide by a fraction that has a numerator and denominator of 10.

$$\frac{2}{10} \times \frac{10}{10} = \frac{20}{100} \qquad \frac{50}{100} \div \frac{10}{10} = \frac{5}{10}$$

{Find an equivalent fraction for each.}

$$\frac{3}{10} = \frac{\quad}{100} \qquad \frac{60}{100} = \frac{\quad}{10} \qquad \frac{7}{10} = \frac{\quad}{100}$$

$$\frac{90}{100} = \frac{\quad}{10} \qquad \frac{1}{10} = \frac{\quad}{100} \qquad \frac{20}{100} = \frac{\quad}{10}$$

$$\frac{4}{10} = \frac{\quad}{100} \qquad \frac{80}{100} = \frac{\quad}{10} \qquad \frac{5}{10} = \frac{\quad}{100}$$

Ayo belajar di Sekolah Rebus Mentoring Bersama AcocadoMY
LIVEWORKSHEETS

Using Division to Find Equivalent Fractions

To find equivalent fractions, you can divide a fraction by a fraction that is equivalent to 1. Divide the numerators and the denominators to find an equivalent fraction.

$\frac{6 \div 2}{12 \div 2} = \frac{3}{6}$

$\frac{6 \div 3}{12 \div 3} = __$

$\frac{6 \div 6}{12 \div 6} = __$

$\frac{6 \div 2}{10 \div 2} = __$

$\frac{4 \div 4}{12 \div 4} = __$

$\frac{5 \div 5}{10 \div 5} = __$

$\frac{2 \div 2}{8 \div 2} = __$

$\frac{8 \div 2}{12 \div 2} = __$

$\frac{3 \div 3}{6 \div 3} = __$

$\frac{3 \div 3}{12 \div 3} = __$

$\frac{4 \div 4}{8 \div 4} = __$

$\frac{4 \div 2}{10 \div 2} = __$

LIVEWORKSHEETS

LIVEWORKSHEETS