Nama :

Kelas :

Kerjakan Soal Berikut !

1. Tarik garis dari bangun datar yang menyusun pengubinan berikut !









LIVEWORKSHEETS