عِنوانُ الدَّرْسُ: الأجزاء من مئة

نَواتِجُ التَّعَلُّمِ: يمثّل ويوضح الأجزاء من مئة باعتبارها جزءاً من نظام عدّ العشرات

التقييم التكويني

صفحة 647

تمارين ذاتية

اكتب كل عدد عشري.

3.

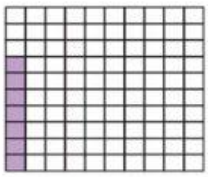

4.

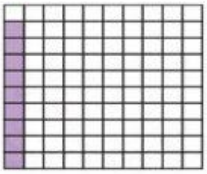

5.

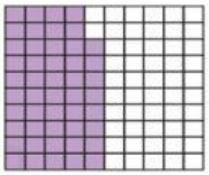

6.

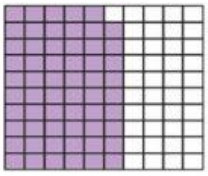

7.

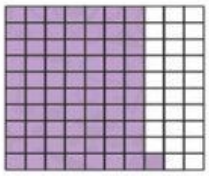

8.

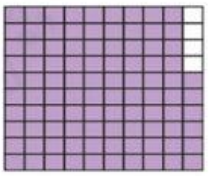

LIVEWORKSHEETS