Math Club Exercise

Nama

Kelas

Berilah tanda > , < , = dari gambar berikut!

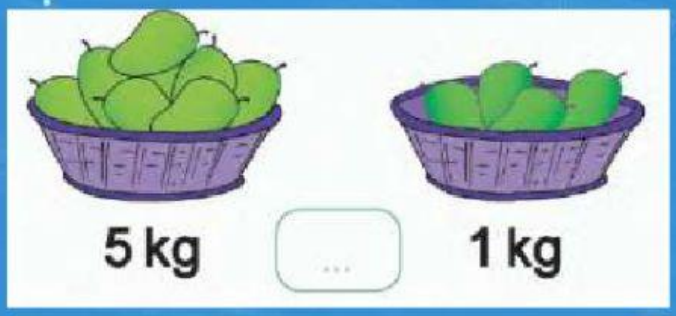

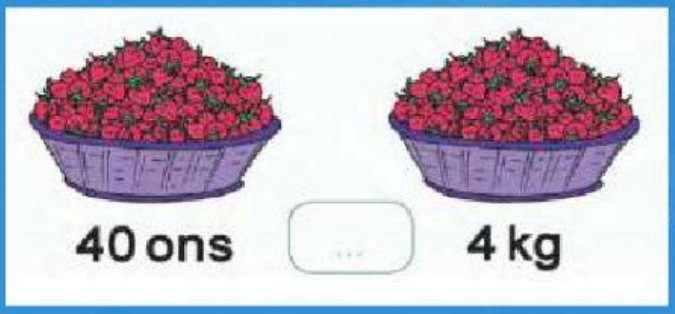

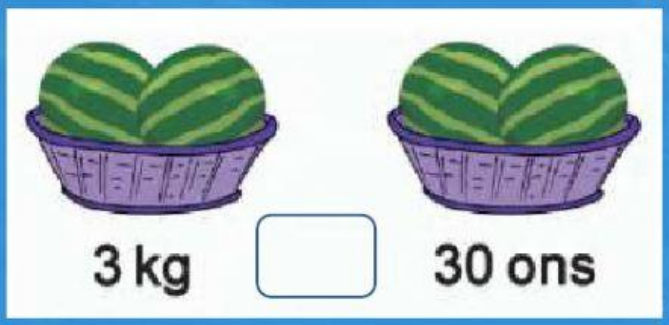

LIVEWORKSHEETS

Ada pot yang beratnya 5 ons. Ada pot yang beratnya 2 ons.

Berilah tanda **>** , **<** , **=** dari gambar berikut!

...

...

LIVEWORKSHEETS